Pendidikan Jasmani | Tahun 1 | 26 Oktober 2021

LIGAT BERPUTAR

Mengenal pasti nama aktiviti berikut dengan betul.

TARIK dan LEPASKAN jawapan ke dalam petak jawapan.

Putaran menegak penuh

Guling sisi

Guling balak

Putaran menegak separa

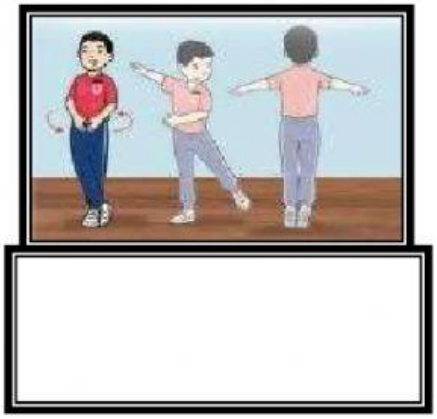





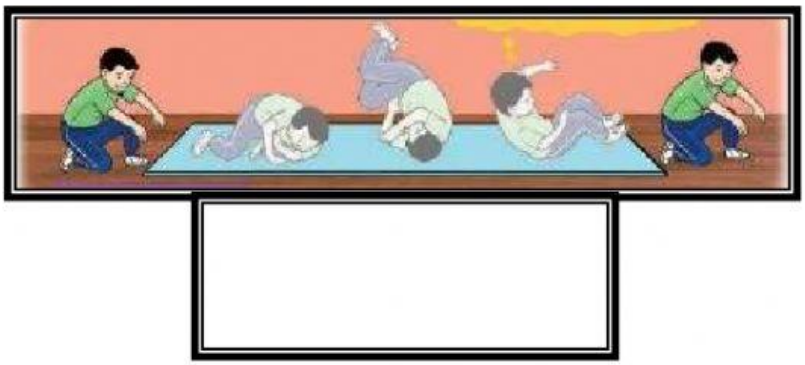

LIVEWORKSHEETS