Nome:

Faça os cálculos no caderno e escreva apenas a resposta final.

1. Sabendo que as retas r, s e t são paralelas, determine o valor de x na imagem a seguir.

a)

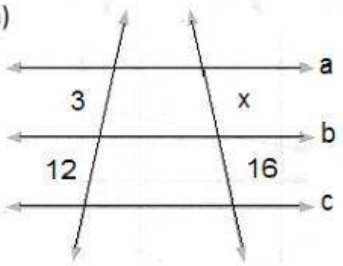

b)

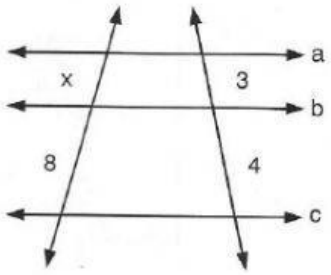

c)

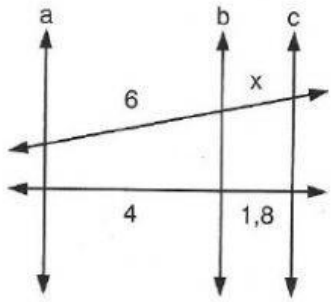

Resposta: Resposta: Resposta:

d)

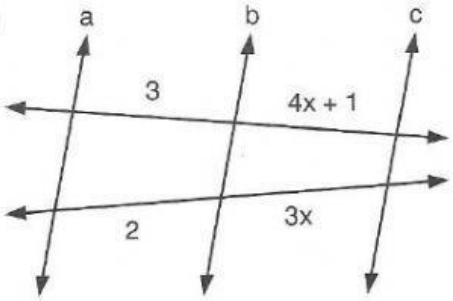

e)

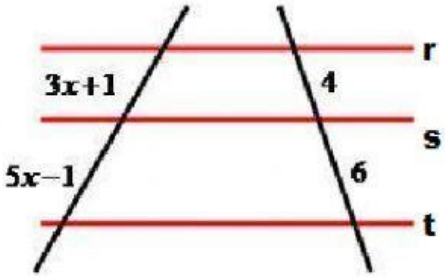

Resposta: Resposta:

2.Calcule x, sabendo que $\overline{BC} // \overline{EF}$:

a)

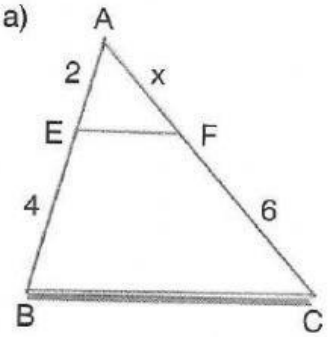

b)

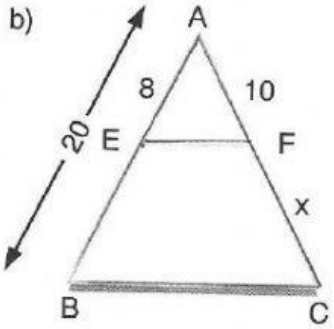

c)

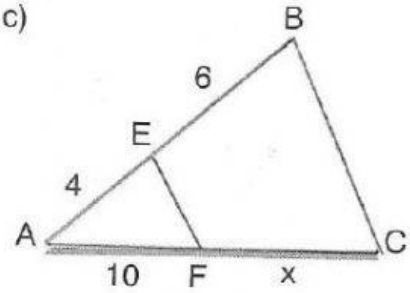

Resposta: Resposta: Resposta:

LIVEWORKSHEETS