MissCandiceP

3D Shapes / Solids and their flat faces

Select the flat shape (plane shape/ 2D shape) that matches the face shown on the Solid shape.

3D Shapes /Solids

Face Shape

1)

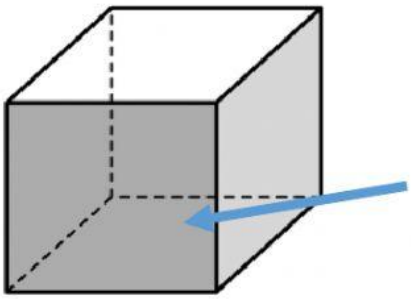

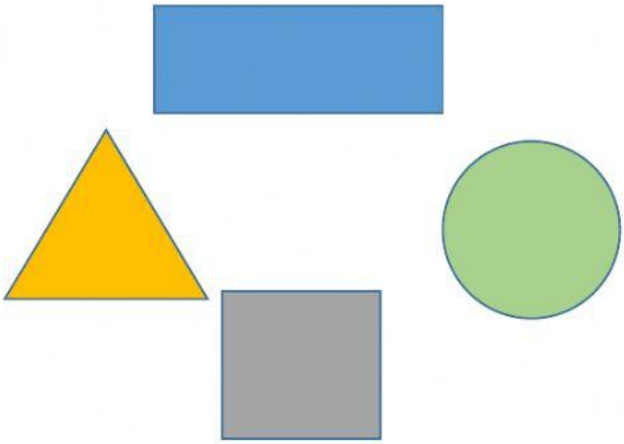

2)



There are _____flat faces on a sphere?

Choose a , b , c or d .

a) 6 flat faces

b) 0 flat faces

c) 2 flat faces

d) 1 flat face

3)



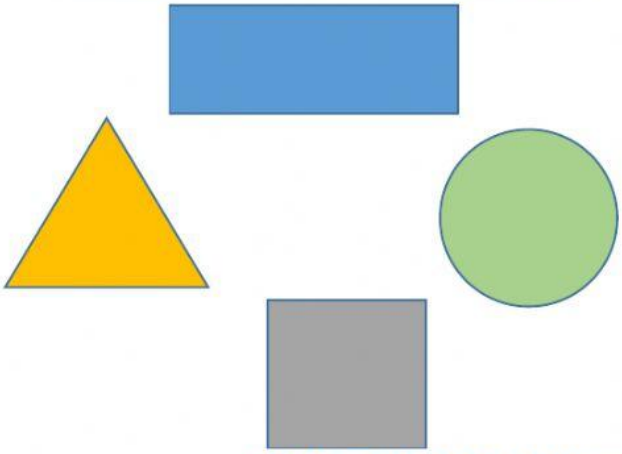

LIVEWORKSHEETS