Pasangkan harga benda dengan kumpulan pecahan uang sesuai harganya !

Rp1.000,00 Rp500,00 Rp800,00 Rp700,00

Perhatikan harga buah tersebut! Pasangkan hargabuah dengan kumpulan pecahan uang yang sesuai!

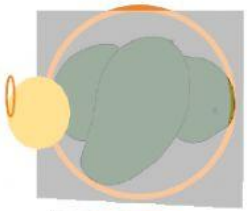



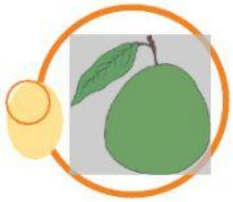



LIVEWORKSHEETS

LIVEWORKSHEETS

LIVEWORKSHEETS