Miss Louis- 2nd Year

Weekly Review 1- Math

Type the number that comes before and after

| | | |
|---|---|---|
| 8 | 9 | |

| | | |
|---|---|---|
| 10 | | 8 |

| | | |
|---|---|---|
| 10 | | 12 |

| | | | |
|---|---|---|---|
| 7 | | | 4 |

Unscramble the number names

1. trhee_____

2. gehit_____

3. net_____

4. sveen _____

Match the objects and complete the sentences

1. ☆ ☆ | 2 | 6 is more than _____

☆ ☆ ☆ ☆ ☆ ☆ | 6 | 6 is ___ more than_____

LIVEWORKSHEETS

2. 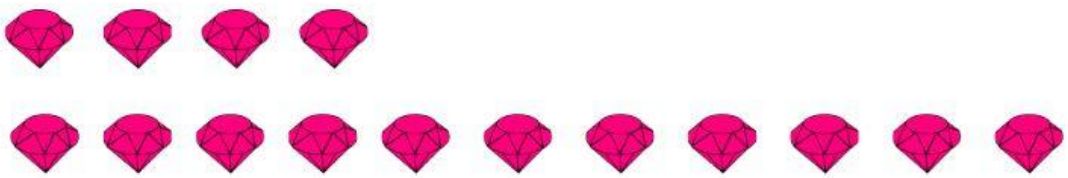

4

11

4 is less than_____

4 is _____ less than _____

Solve the following problems.

1. 5 + 4 =

2. 3 + 8 =

3. + 7 = 11

4. 6 + = 10

Select the shape to match the word name.

square



rectangle

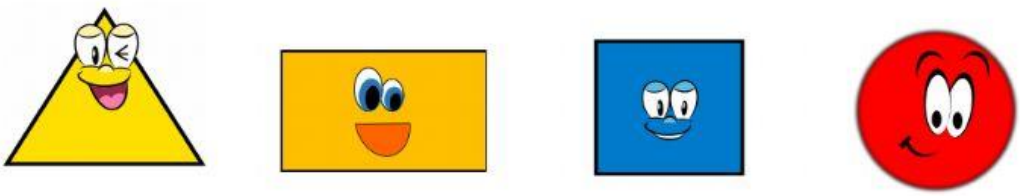

triangle



LIVEWORKSHEETS