KEMAHIRAN 21 : WANG

Kira dan tulis nilai wang yang perlu dibayar.

Barang dibeli	Jumlah dibayar
 20 sen 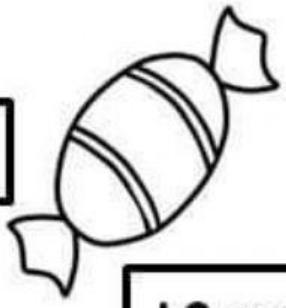 10 sen	
25 sen 50 sen	
30 sen 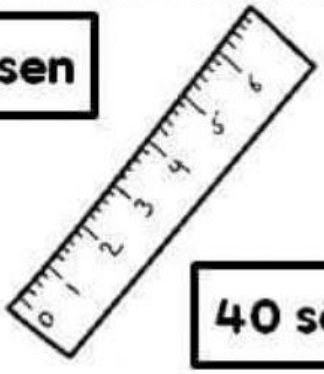 40 sen	
70 sen 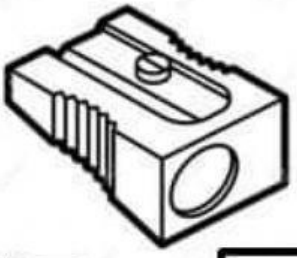 35 sen	

LIVEWORKSHEETS