SUMMATIVE TEST
MATHEMATICS 1
PART 2

*II-A Panuto : Isulat sa kahon ang tamang simbolo na gagamitin sa mga set o bilang*

☐ **1.** 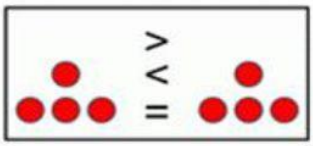


☐ **2.** 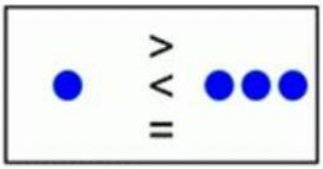


☐ **3.** 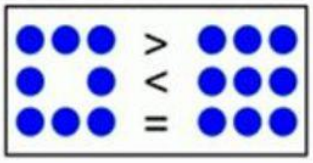


**4.** 55 ☐ 92

**5.** 82 ☐ 74

*II-B Panuto : Lagyan ng / kung ang bilang ng set ay nakaayos mula pinakamaliit hanggang sa pinakamalaki, X naman nakaayous mula pinakamalaki hanggang pinamaliit*

**1.**___ 

**2.**___ 

**3.**_____ 36 37 39

**4.**_____ 51 50 49

**5.**_____ 19 20 21

LIVEWORKSHEETS