# Plane Shapes Classification

Write the name of the shape. Then Write how many sides and corners each shape has.

| Shape | Name | How many sides? | How many corners? |
|---|---|---|---|
|  | | | |
| | | | |
|  | | | |
| | | | |
|  | | | |
|  | | | |

LIVEWORKSHEETS