Math Test 2

1. Write the products.

a. 7×3 b. 4×6 c. 3×4 d. 8×3 e. 4×4 f. 12×3

2. Follow the signs.

a. $285 + 799$ b. $526 - 238$ c. \$28.45 + 53.49 d. \$2.25 − 1.79 e. 85×2

3. Write the time both ways.

_____

or

_____

4. Write the name of the geometric figure.

a. _____

b. _____

c. _____

d. 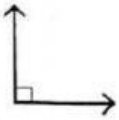 _____

e.  _____

hexagon	intersecting lines	parallel lines
pentagon	perpendicular lines	rhombus
right angle	square	

LIVEWORKSHEETS

5. Fill in the blank.

a.

_____ sides

b.

_____ vertexes

c.

_____ right angles

d.

_____ sides

e.

_____ vertexes

f.

_____ right angles

6. Solve the story problem.

Last year Nathan had 9 cars in his toy car collection. This year he has twice as many. How many cars does he have now? _____ cars

Workspace

7. Write the answers.

a. 1 yd. = _____ ft. b. 1 gal. = _____ qt. c. 1 ft. = _____ in.

d. 1 pt. = _____ c. e. 1 yd. = _____ in. f. 1 qt. = _____ pt.

8. Write the values.

a. 

= _____

b.

= _____

LIVEWORKSHEETS