ÁREA DE POLÍGONOS REGULARES

1.-Completa los espacios con los valores correspondientes y calcula el área del polígono.

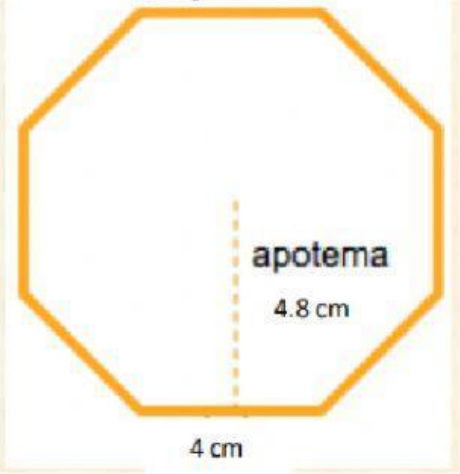

$$A = \frac{P \ x \ ap}{2}$$

$$A = \frac{\square \ cm \ x \ \square \ cm}{2}$$

$$A = \frac{\square}{2} \ cm^2$$

A= $\square$

2.-Selecciona la respuesta correcta:

El siguiente polígono es:

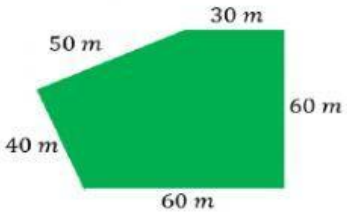

REGULAR

IRREGULAR

3.-Unir el polígono con la fórmula correspondiente para hallar su área

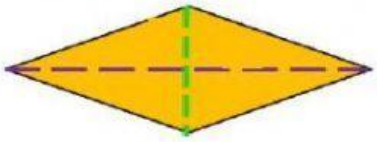

$$A = \frac{P \ x \ ap}{2}$$

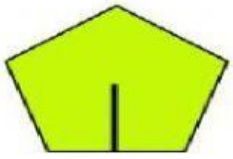

$$A = \frac{D \ x \ d}{2}$$

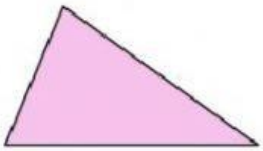

$$A = \frac{b \ x \ h}{2}$$

LIVEWORKSHEETS