Ejercicios Números mixtos

$7\frac{1}{3}$

1. Relaciona los números mixtos con su fracción correspondiente

$3\frac{2}{3}$ $1\frac{1}{3}$ $2\frac{1}{4}$ $5\frac{2}{5}$ $5\frac{2}{3}$

$\frac{17}{3}$ $\frac{9}{4}$ $\frac{27}{5}$ $\frac{4}{3}$ $\frac{11}{3}$

2. Realiza la conversión de los números mixtos

$8\frac{3}{4} = \frac{\square}{\square}$

$9\frac{1}{4} = \frac{\square}{\square}$

$5\frac{1}{8} = \frac{\square}{\square}$

$4\frac{5}{6} = \frac{\square}{\square}$

$1\frac{2}{11} = \frac{\square}{\square}$

$6\frac{7}{10} = \frac{\square}{\square}$

LIVEWORKSHEETS

3. Indica que número mixto representa cada grafica



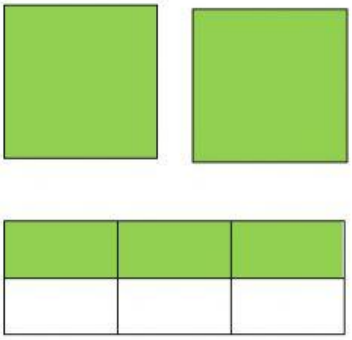



4. Escribe el nombre de cada número mixto

$7\frac{3}{5} =$

$3\frac{7}{9} =$

LIVEWORKSHEETS