Nama : Kelas :

Perkalian

Perhatikan gambar, kemudian isilah kotak-kotak berikut!



[ ] x 6 = [ ]



[ ] x [ ] = [ ]

9 + 9 + 9 + 9 = [ ]

[ ] x 9 = [ ]

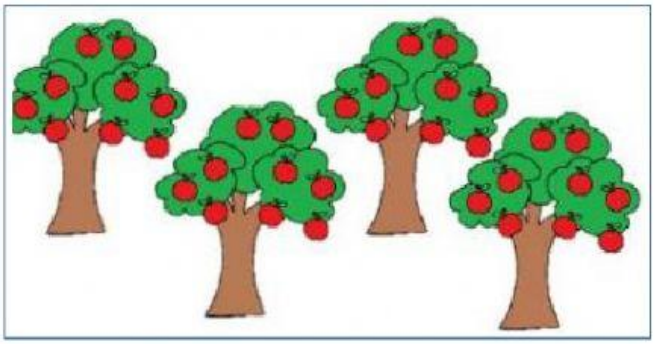



[ ] + [ ] + [ ] + [ ] + [ ] = 40

5 x [ ] = [ ]

[ ] + [ ] + [ ] = [ ]

3 x 9 = [ ]

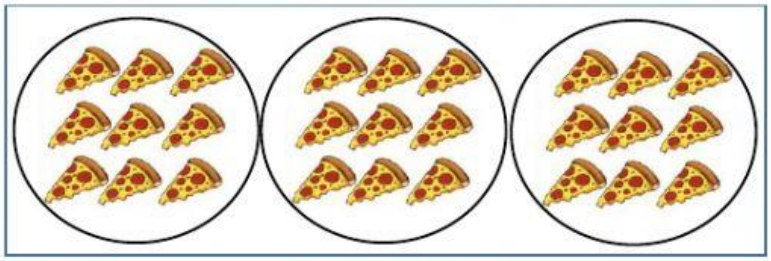

LIVEWORKSHEETS

☐ + ☐ + ☐ = ☐

☐ x ☐ = ☐



☐ + ☐ + ☐ + ☐ = ☐

☐ x ☐ = ☐

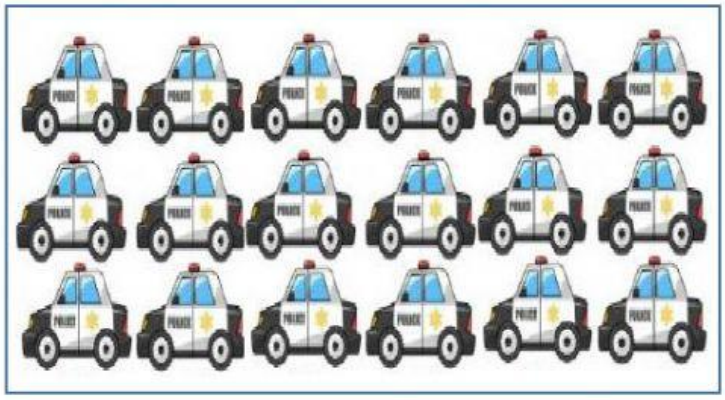

3 x 6 = ☐

☐ x ☐ = 18

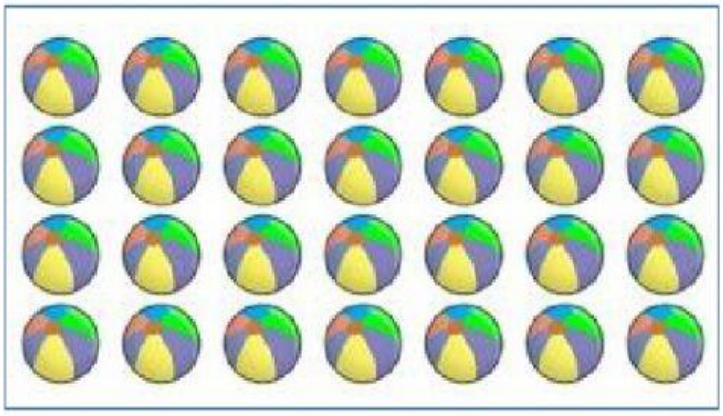

☐ x ☐ = 28

7 x 4 = ☐

☐ x ☐ = 32

☐ x ☐ = 32

LIVEWORKSHEETS

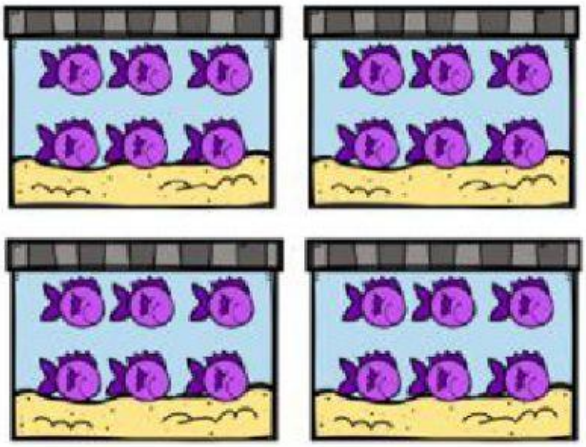

Pa Heri mempunyai 4 aquarium.

Setiap akuarium terdapat 6 ekor ikan.

☐ x ☐ = ☐

Pa Heri mempunyai ☐ ekor ikan.

Mikaila mempunyai 3 kotak minuman.

Setiap kotak berisi 6 minuman.

Jumlah semua minuman

Mikaila adalah ☐

☐ x ☐ = ☐



Ibu membeli 7 ikat buah anggur.

Setiap ikat memiliki 6 anggur.

Jumlah anggur yang dibeli Ibu adalah ☐

☐ x ☐ = ☐

.... x 8 = 48

Nisa telah membaca 9 ayat Al Quran.

Pak Umar membaca 4 kali lebih banyak dari yang dibaca Nisa.

Jumlah ayat yang dibaca Pak Umar adalah ....

LIVEWORKSHEETS