DEMOSTRANDO LO APRENDIDO

Nombres y apellidos:

Fecha:

Nota:

1. Halla el valor de 2α.

RESOLUCION

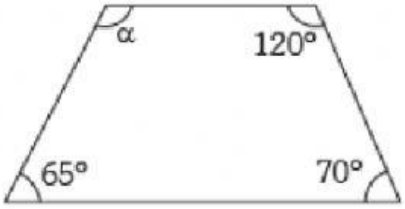

2. Calcula $\frac{\gamma + \beta}{2}$.

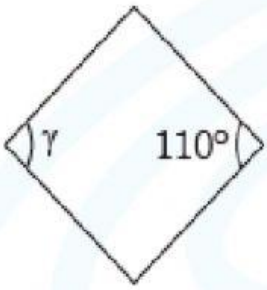

Rombo

Rectángulo

$$\rightarrow \frac{\gamma + \beta}{2} = \frac{\square + \square}{\square} = \frac{\square}{\square}$$

LIVEWORKSHEETS

3. Calcula $(x - y)^2$.

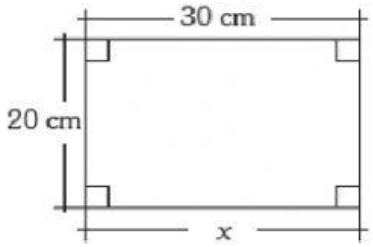

Rectángulo

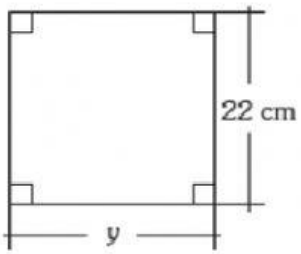

Cuadrado

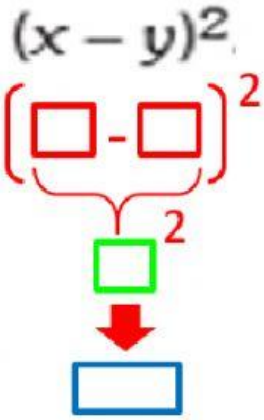

RESOLUCION

RESOLUCION

4. Completa colocando las letras en los espacios, según corresponda.

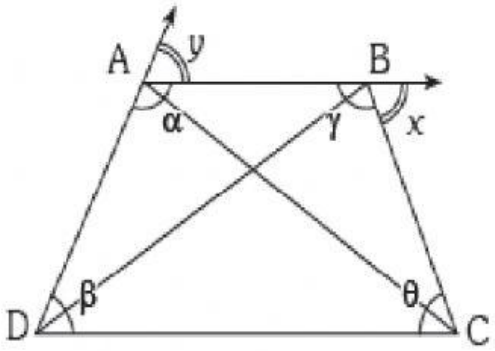

- Vértices: _____
- Lados: _____
- Medida de ángulos internos: _____
- Medida de ángulos externos: _____
- Diagonales: _____

LIVEWORKSHEETS