NAMA : KELAS :

Lengkapkan ayat matematik.

1.



4 − ☐ − ☐ = 0

2.

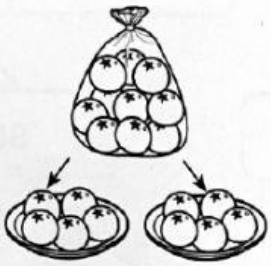

10 − ☐ − ☐ = 0

3.

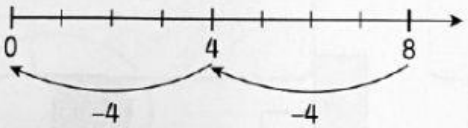

8 − ☐ − ☐ = 0

4.

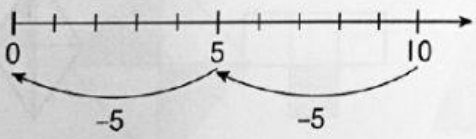

10 − ☐ − ☐ = 0

5.

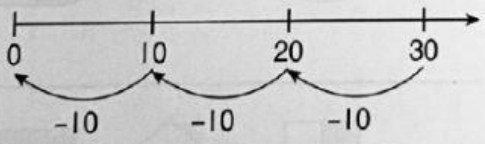

30 − ☐ − ☐ − ☐ = 0

LIVEWORKSHEETS