Measuring Objects using a Ruler | cm

Measure each object using the ruler.

1)

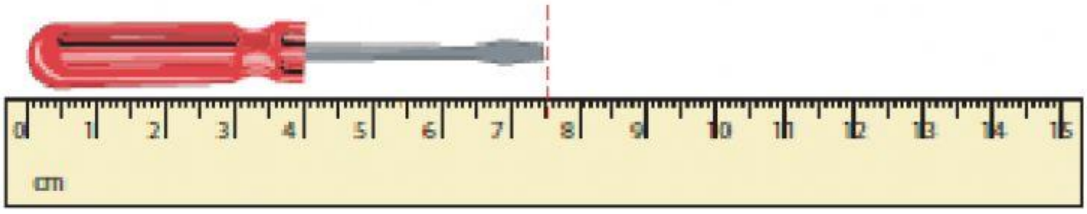

_____ cm

2)

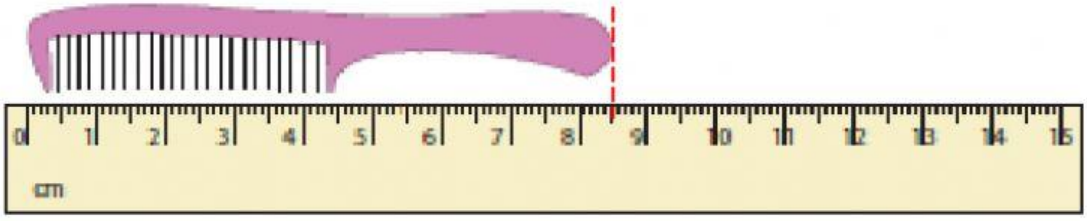

_____ cm

3)

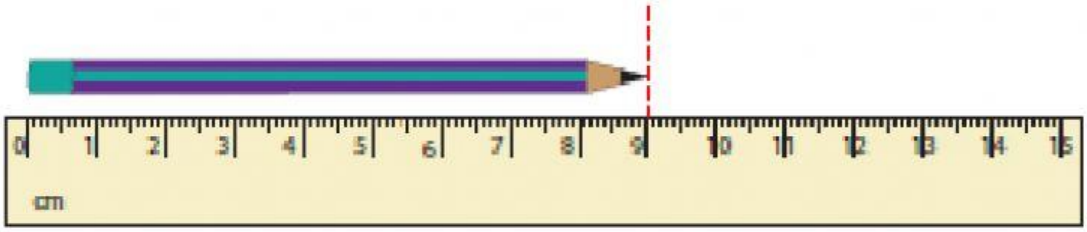

_____ cm

4)



_____ cm

5)

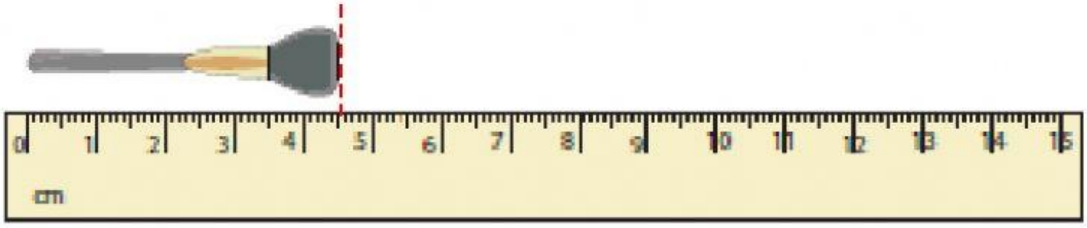

_____ cm

6)

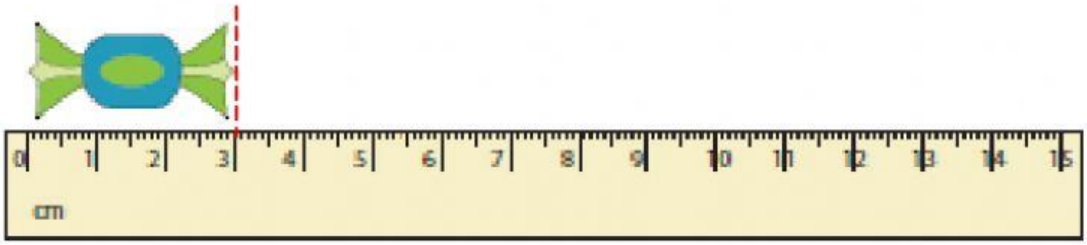

_____ cm

LIVEWORKSHEETS

1. 3 m = _____ cm

2. 5m 20 cm = _____ cm

3. 4560 cm = _____ m _____ cm

4. 3400 cm = _____ m

5. 16 m = _____ cm

6. 5m 45 cm = _____ cm

7. 17m = _____ cm

8. 8m 5cm = _____ cm

LIVEWORKSHEETS