Guía de aprendizaje: Matemática

Fracciones impropias y número mixto

Nombre:_____Fecha:_____

I.L. Expresan fracciones impropias y números mixtos.

Ejemplos:

Representación gráfica	Fracción impropia		Número Mixto
	$\frac{5}{3}$	$=$	$1\frac{2}{3}$
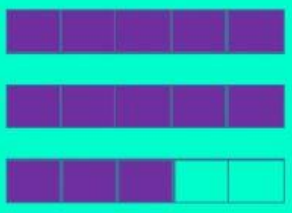	$\frac{13}{5}$	$=$	$2\frac{3}{5}$

Toda fracción impropia la puedes expresar como número mixto.

LIVEWORKSHEETS

Ejercicios:

Escribe la fracción impropia y el número mixto que corresponde a cada representación.

Representación gráfica	Fracción impropia	Número mixto
	$\frac{\square}{\square}$	$\square\,\frac{\square}{\square}$
	$\frac{\square}{\square}$	$\square\,\frac{\square}{\square}$
	$\frac{\square}{\square}$	$\square\,\frac{\square}{\square}$
	$\frac{\square}{\square}$	$\square\,\frac{\square}{\square}$
	$\frac{\square}{\square}$	$\square\,\frac{\square}{\square}$
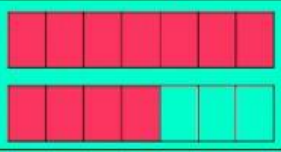	$\frac{\square}{\square}$	$\square\,\frac{\square}{\square}$
	$\frac{\square}{\square}$	$\square\,\frac{\square}{\square}$

LIVEWORKSHEETS