A. Pilihlah jawaban yang tepat di antara huruf A, B, C, D, dan E!

1. Yang merupakan fungsi eksponen adalah ....
   A. $f(x) = \sqrt{3x+5}$
   B. $f(x) = \log x^3$
   C. $f(x) = x^5$
   D. $f(x) = 2^{x+1}$
   E. $f(x) = 4x^2$

2. Grafik fungsi eksponen $y = f(x) = \frac{1}{2}(4^x)$ adalah ....

A.

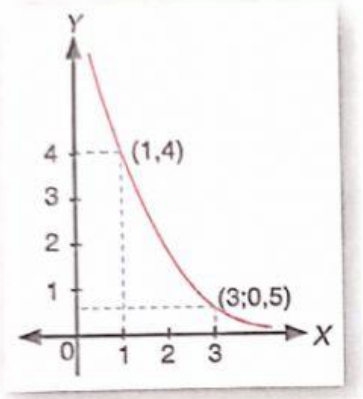

B.

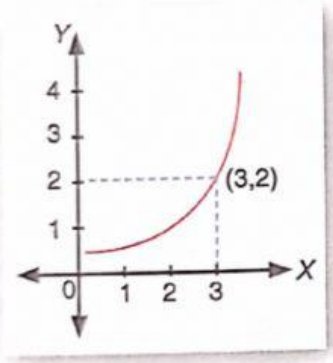

C.

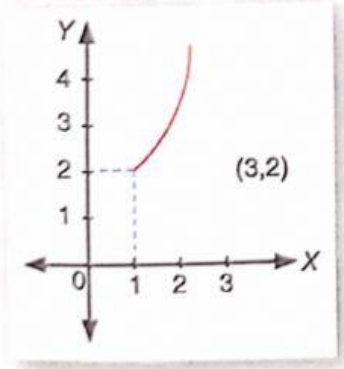

D.

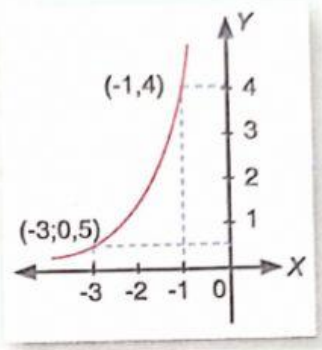

E.

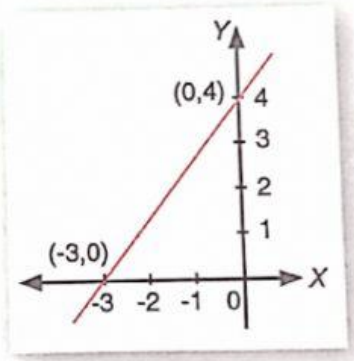

LIVEWORKSHEETS