Part 1	Part 2	Part 3	Part 4A	Part 4B	Total
10	10	10	10	10	50

Sarasas Witaed Chonburi School

Final Progressive Assessment Bilingual Programme Semester 1/2021

Name: ..... **KG 3** /.....

Subject: **Mathematics** **Student Number:** .....

Explanations: This PA consists of 5 pages, 4 parts.

Part 1: **Addition Up to 20**		10 points
Part 2: **Subtraction**		10 points
Part 3: **Expanding Numbers (in words)**		10 points
Part 4A: **Ascending Order**		10 points
Part 4B: **Descending Order**		10 points
	Total	**50 points**

Part 1

10

Directions: Fill in the box with the correct number. Write the number in words on the blank.

8 + 8 = ☐ .....

9 + 5 = ☐ .....

8 + 2 = ☐ .....

10 + 9 = ☐ .....

12 + 8 = ☐ .....

LIVEWORKSHEETS

Part 2

Directions: Write the number in words on the blank.

10

How many pigs are there? _____



Cross out **two**.

How many are left? _____

How many trees are there? _____

Cross out **three**.

How many are left? _____

How many desks are there? _____

Cross out **one**.

How many are left? _____

LIVEWORKSHEETS

How many cats are there? _____



Cross out **five**.

How many are left? _____

How many fish are there? _____

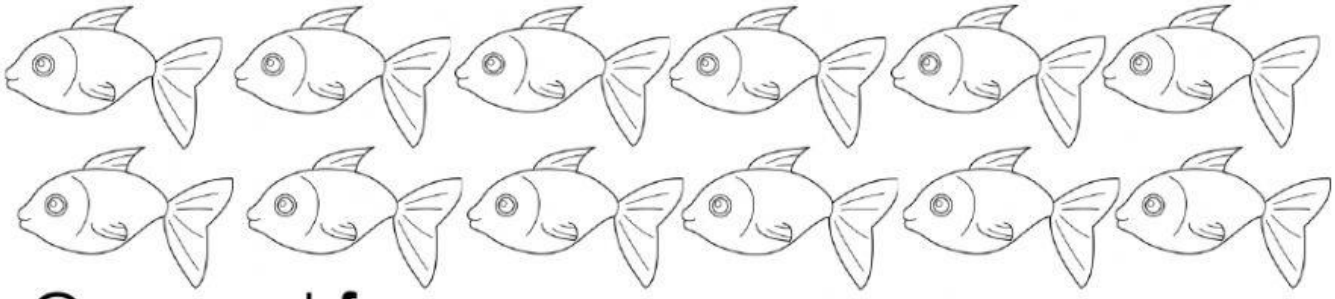

Cross out **four**.

How many are left? _____

Part 3

Directions: Expand the numbers and write in words.

10

28	tens and ones
16	tens and ones
9	ones
13	tens and ones

LIVEWORKSHEETS

29	tens and ones
5	ones

Part 4A

Directions: Arrange the numbers in **ascending** order.

10

1 10 7 15 6 20

8 14 3 20 9 15

9 11 2 16 4 20

5 10 3 19 8 15

8 20 1 15 4 10

LIVEWORKSHEETS

Part 4B

Directions: Arrange the numbers in **descending** order.

10

1 10 7 20 6 15

8 14 5 19 3 11

2 11 5 20 9 13

6 12 3 18 1 15

5 20 3 18 8 11

LIVEWORKSHEETS