CUADRILÁTEROS -PROPIEDADES

1. Calcula el valor de α.



$\alpha =$

2. Determina el valor de 2α.

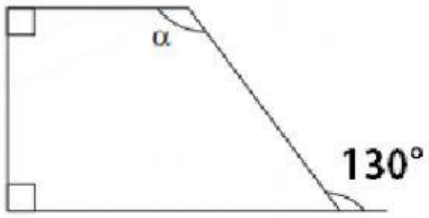

$\alpha =$

$2\alpha \Rightarrow$

3.Calcula el valor de θ.

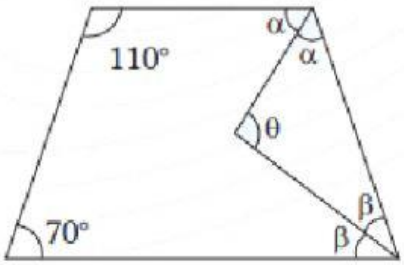

$\theta =$

4. Halla el valor de x.

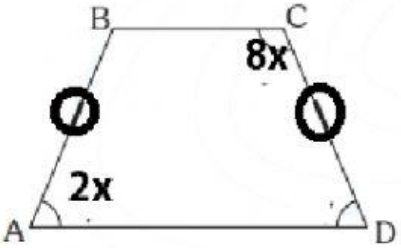

$x =$

5. Halla la base media.

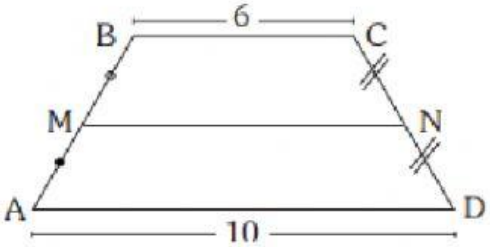

$MN =$

LIVEWORKSHEETS