Practice 4 Time Taken in Hours and Minutes

1. Find the duration of time.

Example

Start

1 h

Duration

End

(a)

Start

Duration

End

(b)

Start

Duration

End

(c)

Start

Duration

End

LIVEWORKSHEETS

2. Find the duration of time.

Example

Start

30 min

Duration

End

(a)

Start

Duration

End

(b)

Start

Duration

End

(c)

Start

Duration

End

LIVEWORKSHEETS

3. Fill in the blanks with the correct time.
Check by drawing the hands of the clock as shown.

Example

5.00
Start

1 h
Duration

6.00
End

(a)

11.00
Start

2 h
Duration

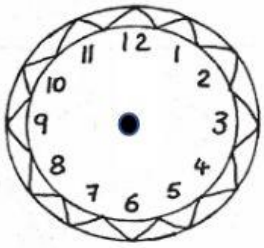

End

(b)



8.00
Start

5 h
Duration

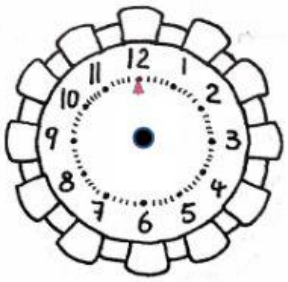

End

LIVEWORKSHEETS

4. Fill in the blanks with the correct time.
Check by drawing the hands of the clock as shown.

Example

1.30	30 min Duration	2.00
Start		End

(a)

	15 min Duration	
Start		End

(b)

	20 min Duration	
Start		End

LIVEWORKSHEETS