I. FRACCIONES EN LA RECTA NUMÉRICA

1. Ubica cada una de las fracciones en la recta numérica. marca el recuadro, según corresponda.

a. $\frac{2}{2}$ →

b. $\frac{4}{6}$ →

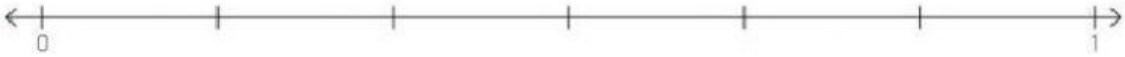

c. $1\frac{3}{4}$ →



d. $1\frac{1}{3}$ →

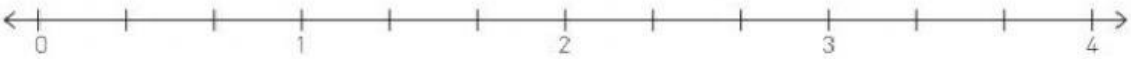

e. $\frac{13}{9}$

f. $3\frac{1}{4}$



g. $\frac{8}{18}$

h. $\frac{14}{8}$

LIVEWORKSHEETS
LIVEWORKSHEETS

2. Escribe en cada casilla la fracción representada.

a.

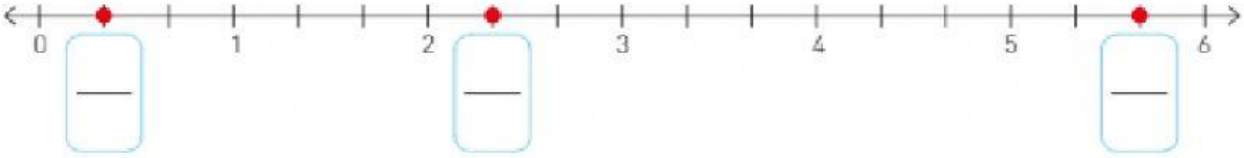

b.

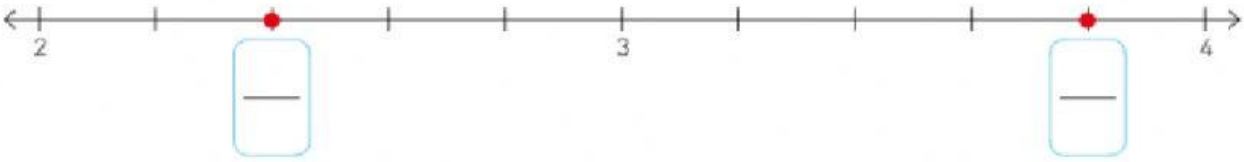

c.

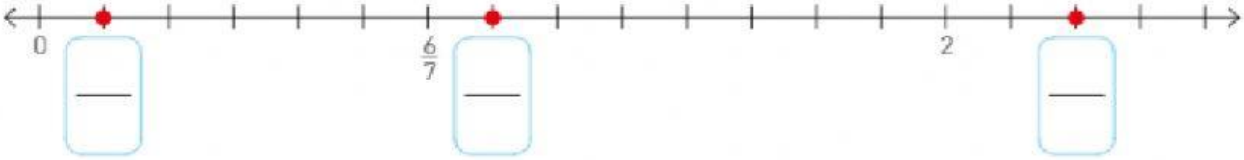

d.

e.

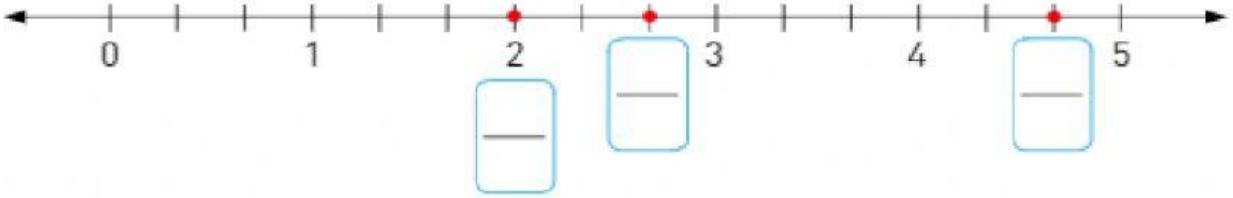

f.

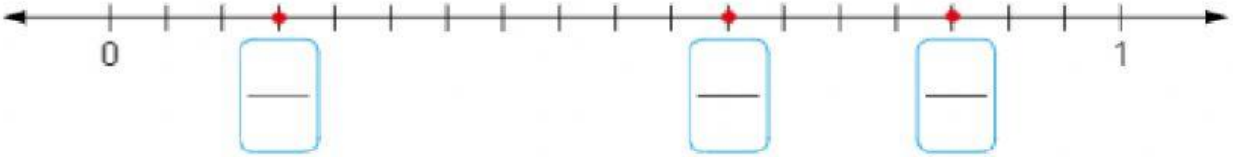

g.

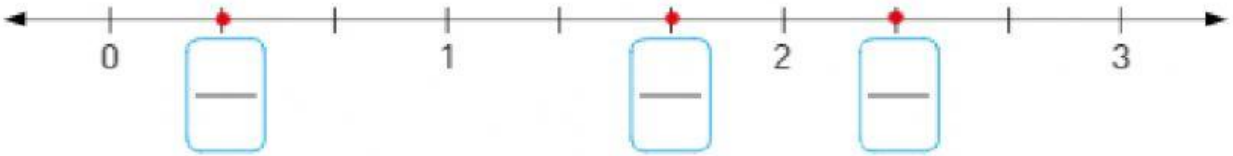

LIVEWORKSHEETS
LIVEWORKSHEETS