Vektoru saskaitīšana un atņemšana. Vektoru izteikšana ar dotajiem vektoriem.

Izvēlies pareizo atbildi!

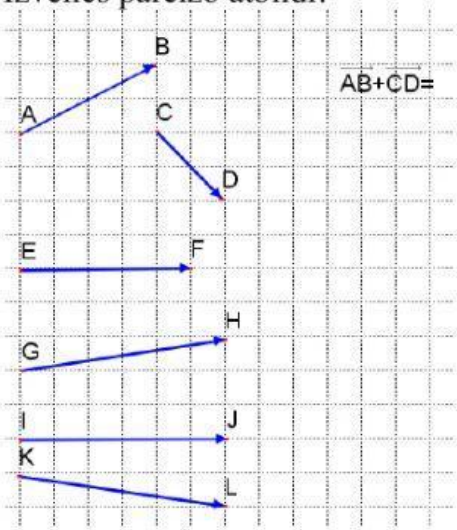

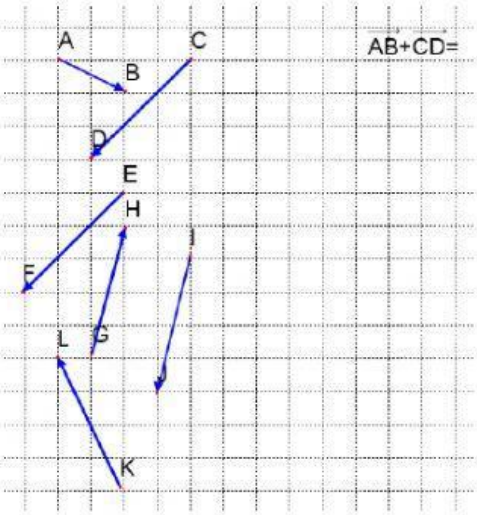

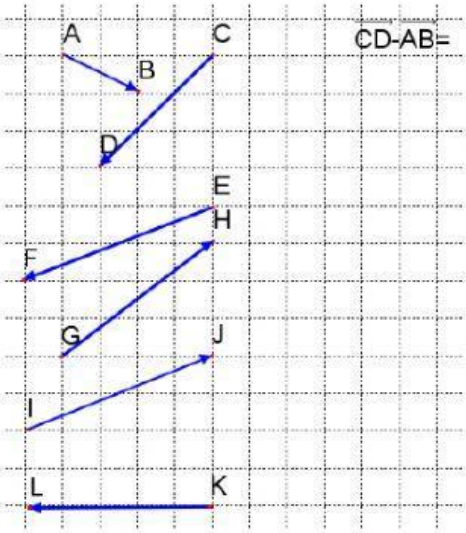

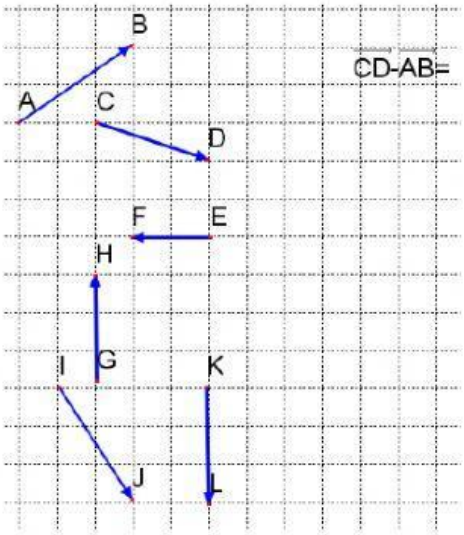

Izsaki vektoru DE ar dotajiem vektoriem.

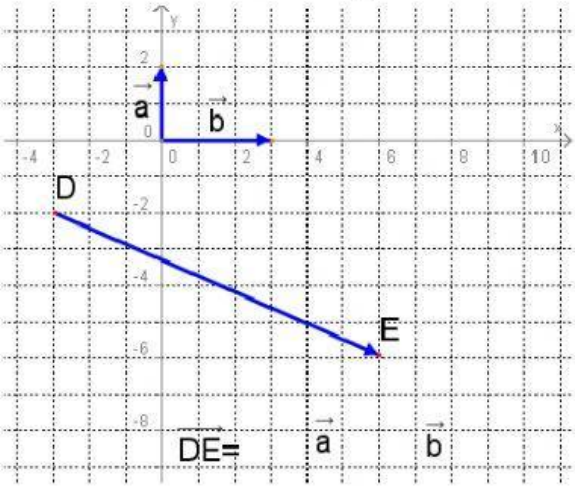

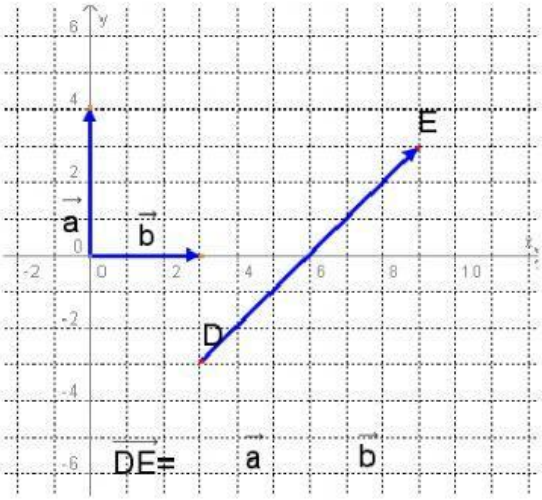

LIVEWORKSHEETS

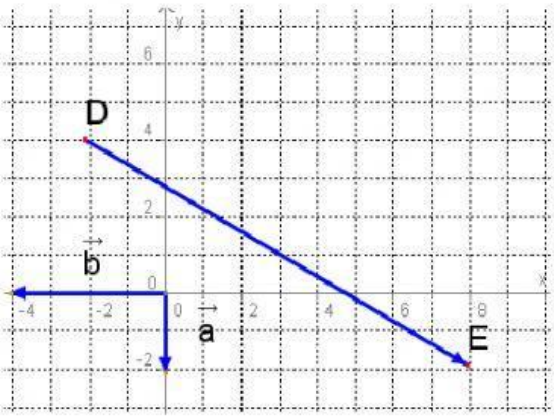

$\overrightarrow{DE} =$ $\vec{a}$ $\vec{b}$

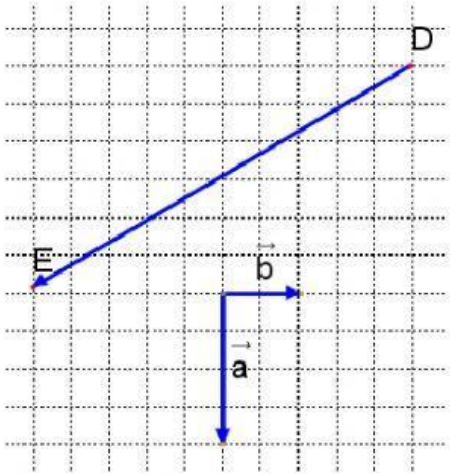

$\overrightarrow{DE} =$ $\vec{a}$ $\vec{b}$

Izvēlies pareizo atbildi!

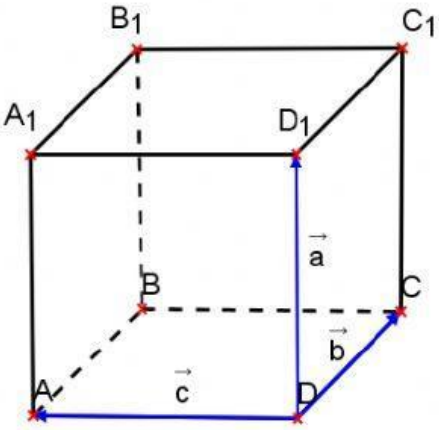

$\overrightarrow{CB_1}=\vec{b}+\vec{c}$

$\overrightarrow{CB_1}=\vec{a}+\vec{c}$

$\overrightarrow{CB_1}=\vec{a}+\vec{b}$

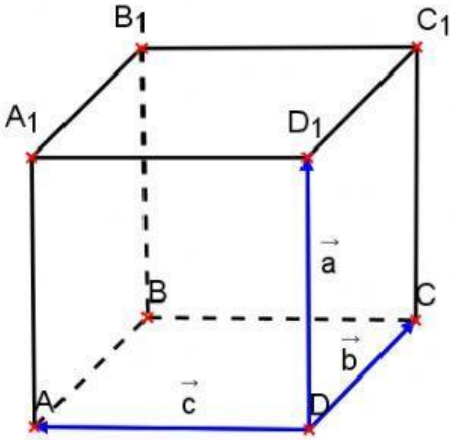

$\overrightarrow{AC_1} = \vec{a} + \vec{b} + \vec{c}$

$\overrightarrow{AC_1} = \vec{a} - \vec{b} + \vec{c}$

$\overrightarrow{AC_1} = \vec{a} + \vec{b} - \vec{c}$

$\overrightarrow{AC_1} = \vec{a} - \vec{b} - \vec{c}$

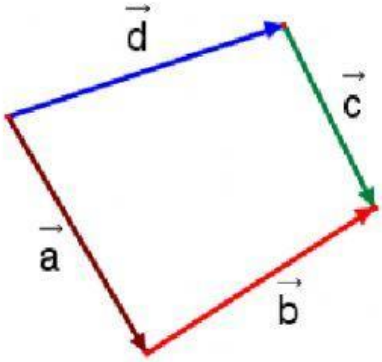

$\vec{a} = \vec{b} + \vec{c} + \vec{d}$

$\vec{a} = \vec{d} + \vec{b} - \vec{c}$

$\vec{a} = \vec{d} - \vec{b} + \vec{c}$

$\vec{a} = \vec{d} - \vec{b} - \vec{c}$

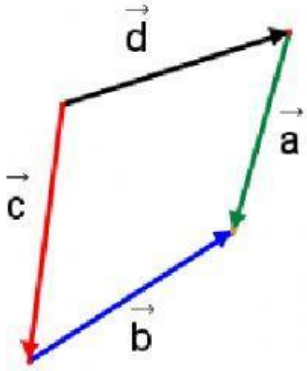

$\vec{a} = \vec{b} + \vec{c} - \vec{d}$

$\vec{a} = \vec{d} + \vec{b} - \vec{c}$

$\vec{a} = \vec{d} - \vec{b} + \vec{c}$

$\vec{a} = \vec{d} - \vec{b} - \vec{c}$

LIVEWORKSHEETS