Törtek helye a számegyenesen

1. Fgy 91/519

Húzd a számokat a megfelelő helyre a számegyenesen!

a) $\frac{1}{2}$, 1, $\frac{5}{2}$, $3+\frac{1}{2}$, 5, $\frac{11}{2}$

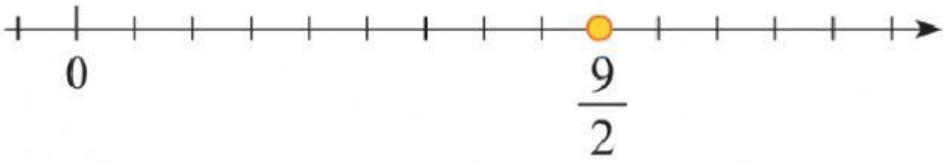

b) $\frac{1}{3}$, $\frac{6}{3}$, $2+\frac{1}{3}$, 3, $\frac{10}{3}$, $4+\frac{1}{3}$

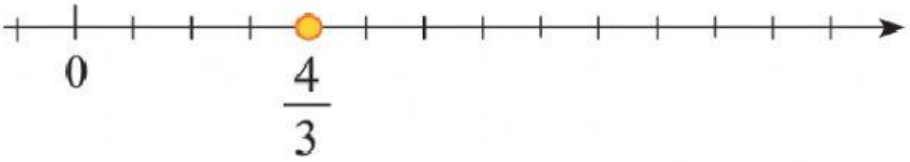

c) $\frac{1}{4}$, $\frac{4}{4}$, 2, $\frac{9}{4}$, $3+\frac{1}{4}$, $\frac{16}{4}$



d) $\frac{1}{5}$, $\frac{6}{5}$, $1+\frac{4}{5}$, $\frac{10}{5}$, $2+\frac{3}{5}$

LIVEWORKSHEETS

2. Fgy. 91/521

Írd a számegyenes sárga ponttal megjelölt helyeire a megfelelő törteket! A negatív előjelet a számlálóba írd!

a)

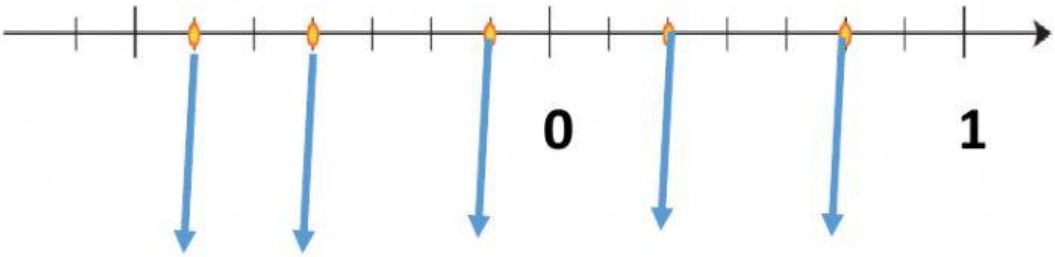

— — — — —

b)

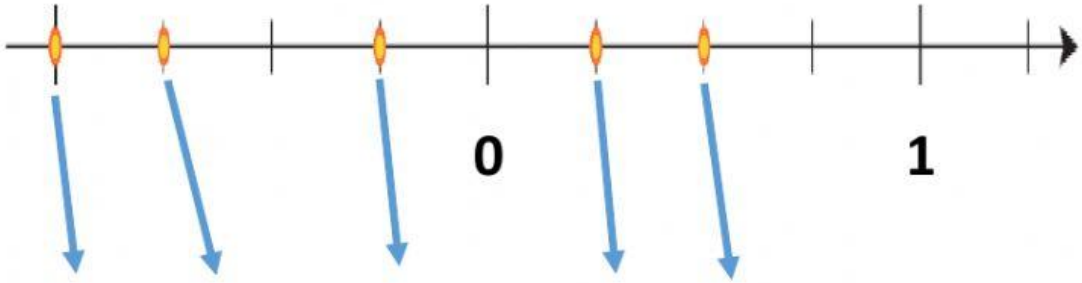

— — — —

c)

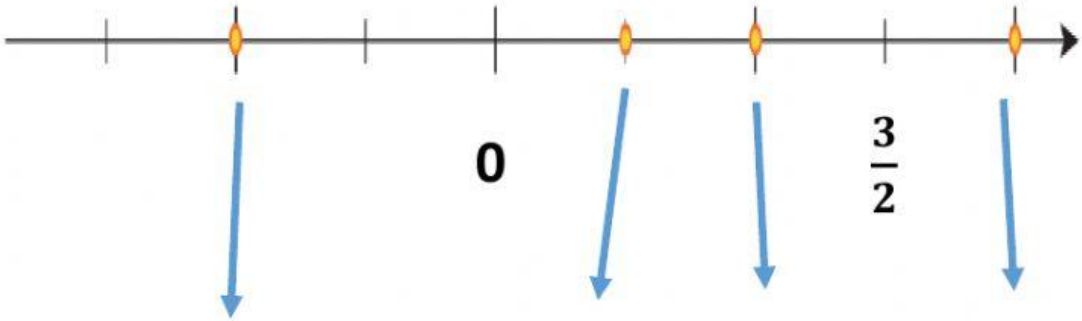

—

LIVEWORKSHEETS

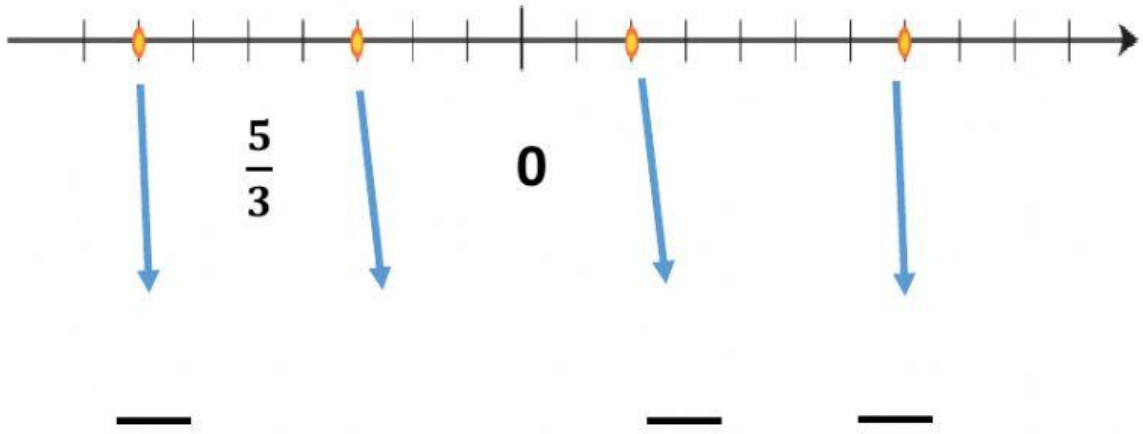

LIVEWORKSHEETS