Nama: _____ Tarikh: _____

CUBA JAWAB

1 Sebut pecahan bagi satu bahagian.

a

b

c 

d

$\frac{\square}{\square}$ $\frac{\square}{\square}$ $\frac{\square}{\square}$ $\frac{\square}{\square}$

2 Apakah pecahan bahagian biru?

a 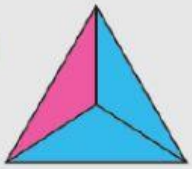

b

c 

d 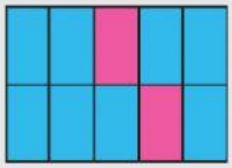

$\frac{\square}{\square}$ $\frac{\square}{\square}$ $\frac{\square}{\square}$ $\frac{\square}{\square}$

3 Pecahan bahagian merah.



$\frac{\square}{\square}$ $\frac{\square}{\square}$

LIVEWORKSHEETS

CUBA JAWAB

1 Tulis pecahan bahagian merah.

a

b

c

2 Tulis pecahan bahagian kuning.

a 

b 

c 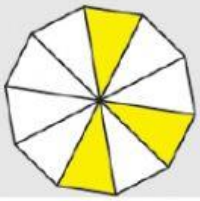

3 Tulis pecahan dalam perkataan.

a $\frac{1}{5}$

b $\frac{1}{7}$

c $\frac{6}{9}$

d $\frac{9}{10}$

4 Tulis pecahan dalam angka.

a satu perlima $\frac{\square}{\square}$

b satu persepuluh $\frac{\square}{\square}$

c dua perlapan $\frac{\square}{\square}$

d lima persembilan $\frac{\square}{\square}$

LIVEWORKSHEETS