Nombre: _____ Fecha: _____

©MagiaEducativa2021

Valor Posicional

Escribe la cantidad de la tabla de valor relativo y luego escribe el número que forma.

centena	decena	unidad
		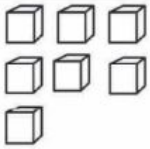

forma numérica = _____

centena	decena	unidad
		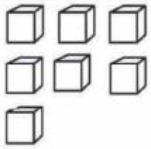

forma numérica = _____

centena	decena	unidad
		

forma numérica = _____

centena	decena	unidad
		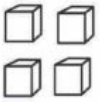

forma numérica = _____

LIVEWORKSHEETS

Nombre: _____ Fecha: _____

Valor Posicional

Escribe el número que representa los bloques.

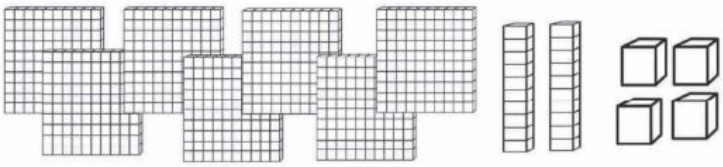	
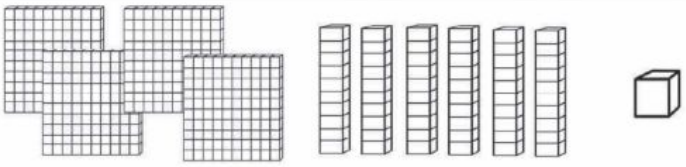	
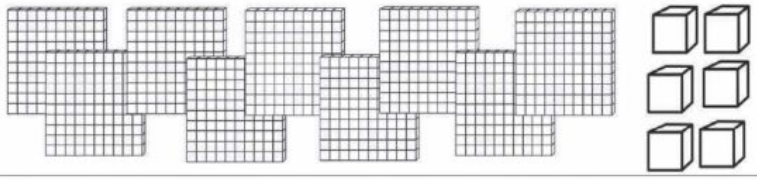	
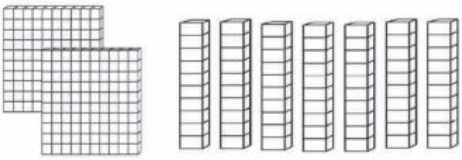	

©MagicEducation2021
LIVEWORKSHEETS