HỖN SỐ

Bài 1: Dựa vào hình vẽ dưới đây để viết hỗn số và phân số tương ứng. (theo mẫu)

Hình minh họa	Phân số	Hỗn số
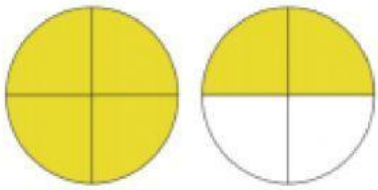	$\frac{6}{4}$	$1\frac{2}{4}$
	___	___
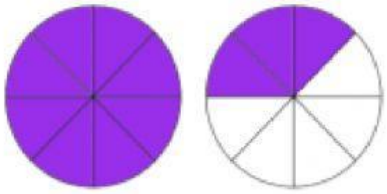	___	___
	___	___
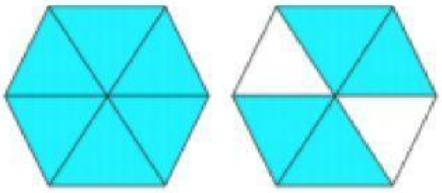	___	___
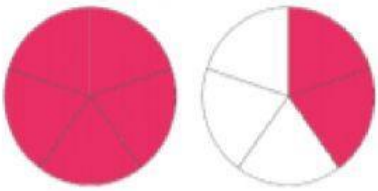	___	___

LIVEWORKSHEETS

Bài 2: Dựa vào hình để viết rồi đọc hỗn số thích hợp (theo mẫu):

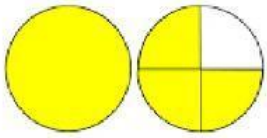

Viết: $1\frac{3}{4}$ Đọc: một và ba phần tư



Viết: ___ Đọc:



Viết: ___ Đọc:

Bài 3: Nối mỗi hình minh họa dưới đây với hỗn số biểu thị tương ứng:





$1\frac{5}{8}$ $1\frac{1}{2}$ $2\frac{1}{2}$

LIVEWORKSHEETS