PENILAIAN HARIAN MATEMATIKA
"KD 3.2 – GARIS BILANGAN & PECAHAN SEDERHANA"

Nama : Kelas/No: /

A. Tulislah bentuk penjumlahan sesuai garis bilangan berikut!

1. 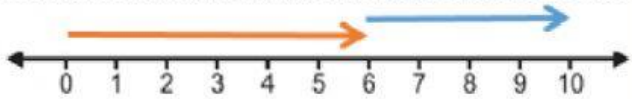

..... + ... = ...

2. 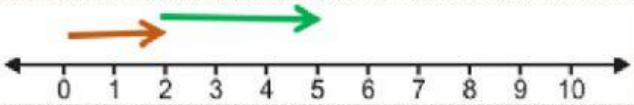

..... + ... = ...

3.

..... + ... = ...

4. 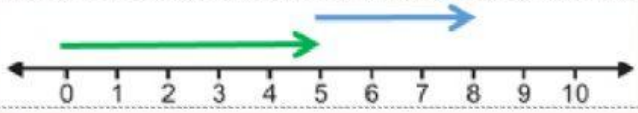

..... + ... = ...

5. 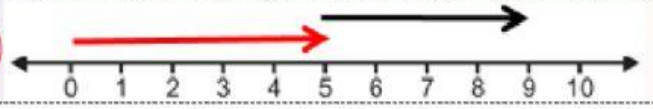

..... + ... = ...

LIVEWORKSHEETS

B. Pilihlah jawaban yang tepat dari penjumlahan dengan menggunakan garis bilangan!

6

$3 + 6 = ...$

A.

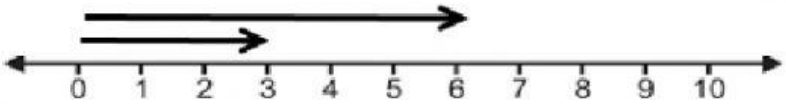

B.

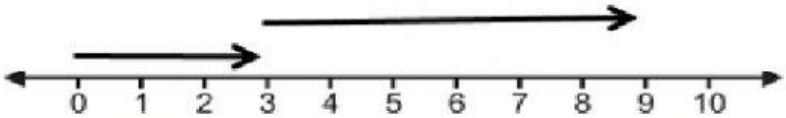

7

$4 + 2 = ...$

A.

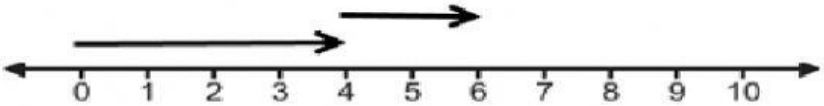

B.



8

$5 + 5 = ...$

A.

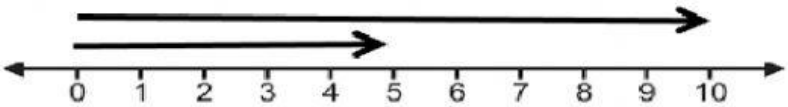

B.

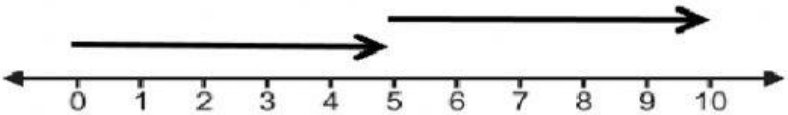

9

$6 + 2 = ...$

A.

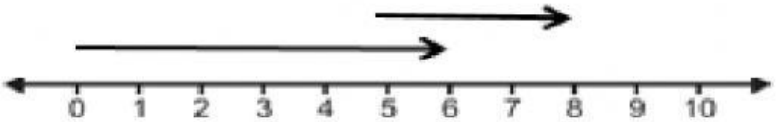

B.

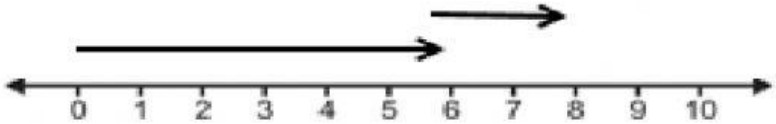

LIVEWORKSHEETS

C. Tentukan nilai pecahan dari gambar yang diarsir!

10



$\frac{\quad}{\quad}$

11



$\frac{\quad}{\quad}$

12



$\frac{\quad}{\quad}$

13

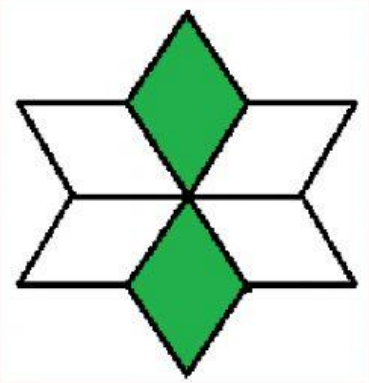

$\frac{\quad}{\quad}$

14

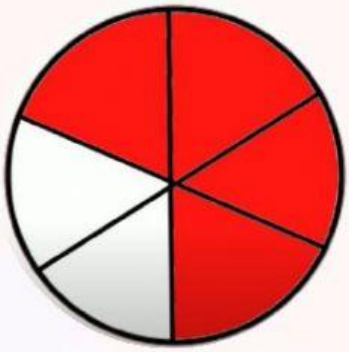

$\frac{\quad}{\quad}$

LIVEWORKSHEETS

C. Tentukan bentuk pecahannya!

15 Bentuk pecahan tiga perdelapan ditulis ___

16 Bentuk pecahan lima persepuluh ditulis ___

17 Bentuk pecahan lima persepuluh ditulis ___

C. Tentukan bentuk pecahan yang sesuai dari soal cerita berikut!

18 Wati membeli 8 permen. Wati memakan 3 permen tersebut. Berapa bagian permen yang sudah dimakan Wati?

19 Sandi membuat 10 kue. 4 kue dimakan Didik. Berapa bagian kue Sandi yang belum dimakan?

20 Mega memiliki 3 ikat rambut berwarna merah, 4 ikat rambut berwarna hijau dan 2 ikat rambut berwana kuning. Berapa banyak bagian ikat rambut berwarna hijau terhadap seluruh ikat rambut milik Mega?

LIVEWORKSHEETS