ชื่อ ..... นามสกุล ..... ชั้น ..... เลขที่ .....

นำเศษส่วนที่กำหนดให้ต่อไปนี้เติมลงใต้ภาพที่แรเงาให้ถูกต้อง .....>>>>>>>>

$\frac{3}{8}$ $\frac{4}{11}$ $\frac{4}{8}$ $\frac{5}{12}$ $\frac{7}{8}$ $\frac{2}{6}$

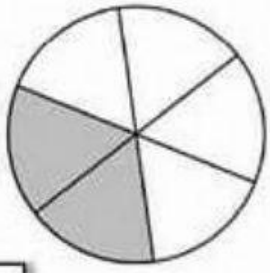

1 ตอบ .....



2 ตอบ .....

3 ตอบ .....

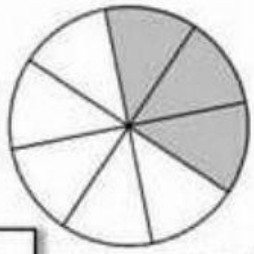

4 ตอบ .....

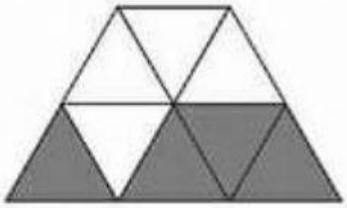

5 ตอบ .....

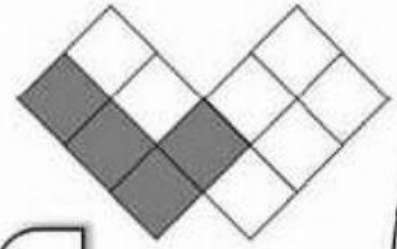

6 ตอบ .....

LIVEWORKSHEETS