ชื่อ – นามสกุล.....

ชั้น ม.2/..... เลขที่.....

แบบฝึกทักษะที่ 3.6

เรื่อง ทรงกระบอก

คำชี้แจง ให้นักเรียนหาคำตอบต่อไปนี้ให้ถูกต้อง

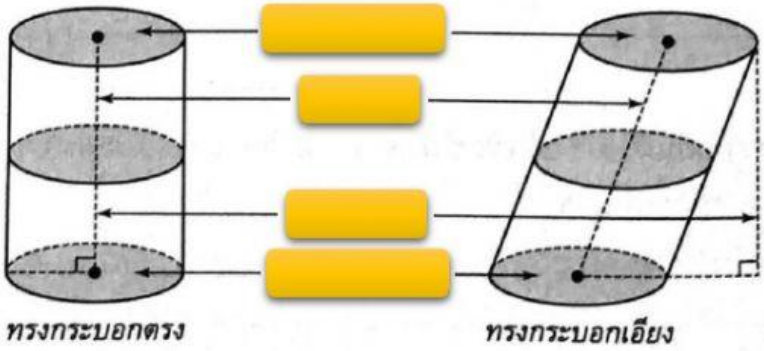

คำชี้แจง ให้นักเรียนหาเลือกรูปต่อไปนี้ที่เป็นทรงกระบอก

1) 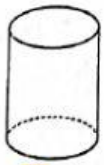
.....

2) 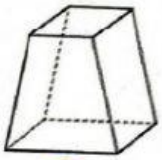
.....

3) 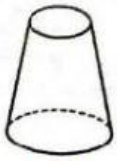
.....

4) 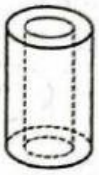
.....

5) 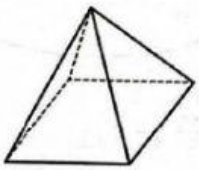
.....

6) 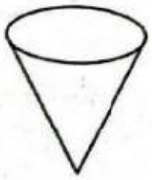
.....

7) 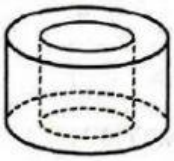
.....

8) 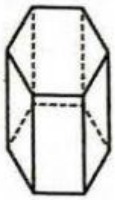
.....

9)
.....

10)
.....

11) 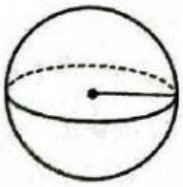
.....

12) 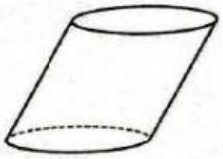
.....

LIVEWORKSHEETS