6:01 PM Mon Sep 6 68%
cdn.fbsbx.com (2)
www.mathsisfun.com
cdn.fbsbx.com (2)
1

# Angle Bisector Constructions

**Locate the incenter of each triangle.**

5)

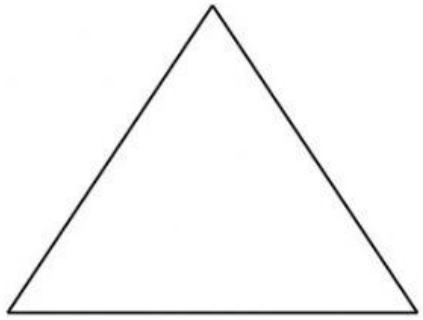

6)

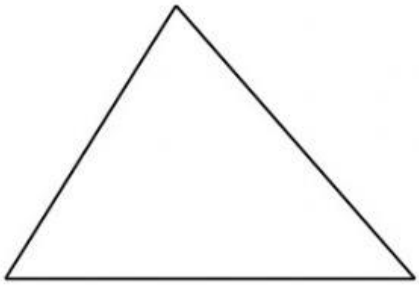

**Construct all 3 angle bisectors in each triangle to show they are concurrent.**

7)

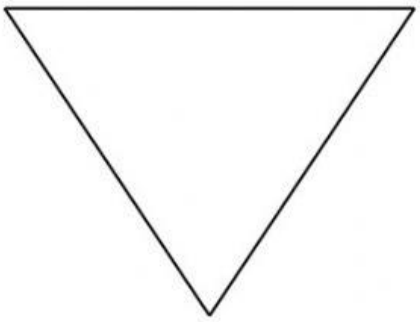

8)

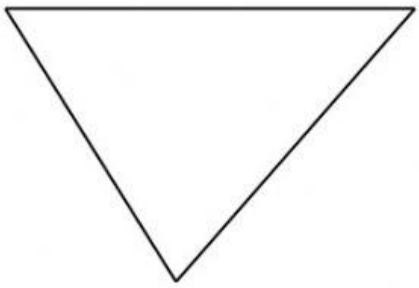



LIVEWORKSHEETS