PUNTO MEDIO

Nombre: _____

Halla el punto medio en cada segmento de líneas

1.

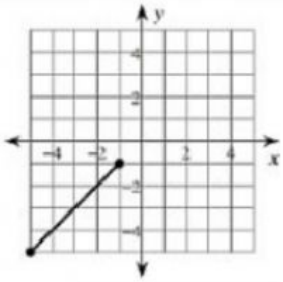

M = _____

2.

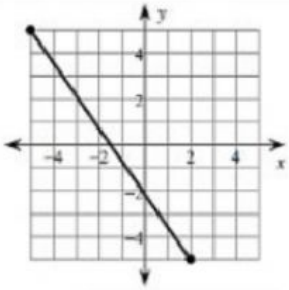

M = _____

3.

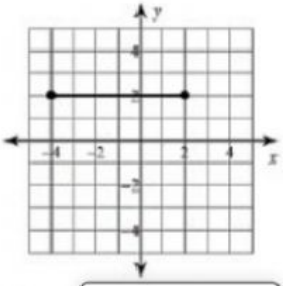

M = _____

4.

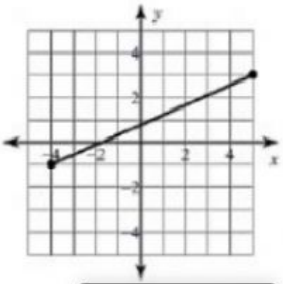

M = _____

Halla el punto medio del segmento que se forma con las coordenadas de los segmentos dados

	Extremos		Punto medio
1.	$(-1, 9)$	$(-17, -29)$	
2.	$(-6, 4)$	$(14, 12)$	
3.	$(-5.1, -2)$	$(1.4, 1.7)$	
4.	$(2.1, 3.5)$	$(1.9, -1.5)$	

LIVEWORKSHEETS