Find the area of the following irregular shapes.

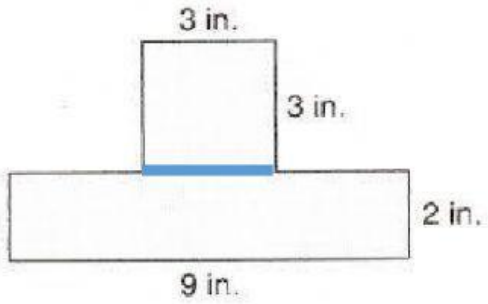

A1: ☐ x ☐ = ☐

A2: ☐ x ☐ = ☐

Total Area: ☐

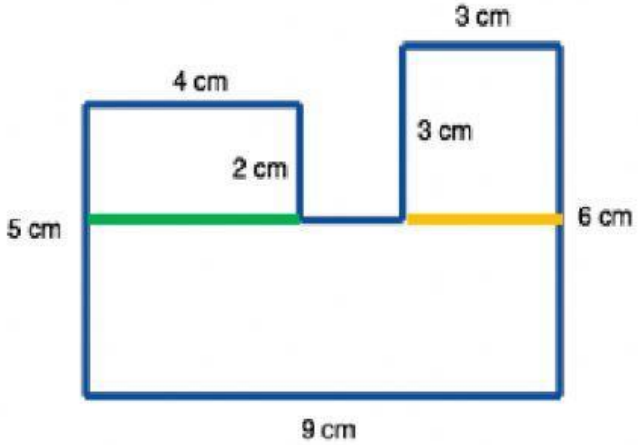

A1: ☐ x ☐ = ☐

A3: ☐ x ☐ = ☐

A2: ☐ x ☐ = ☐

Total Area: ☐

LIVEWORKSHEETS

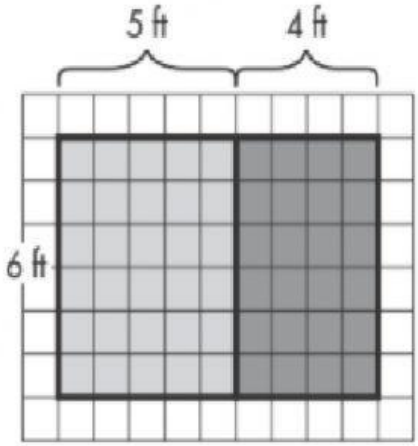

Complete the equations to show that the area of the large rectangle is equal to the sum of the areas of the smaller rectangles.

$6 \times 9 = 6 \times (5 + 4)$

$6 \times 9 = (6 \times 5) + (6 \times 4)$

$6 \times 9 =$ _____ + _____

$6 \times 9 =$ _____

Complete the equations to represent the picture.

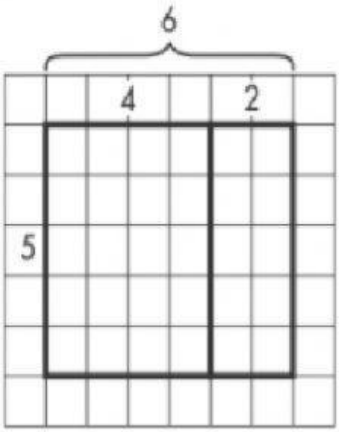

$5 \times$ _____ = _____ $\times (4 +$ _____ $)$

$5 \times$ _____ = $(5 \times$ _____ $) + ($_____ $\times 2)$

$5 \times$ _____ = _____ + _____

$5 \times 6 =$ _____

LIVEWORKSHEETS