Pilih jawapan yang betul.

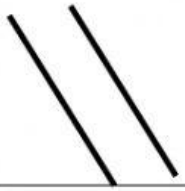				
Garis Selari	Garis Selari	Garis Selari	Garis Selari	Garis Selari
Bukan Garis Selari	Bukan Garis Selari	Bukan Garis Selari	Bukan Garis Selari	Bukan Garis Selari

	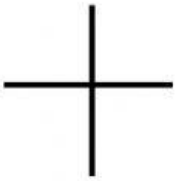	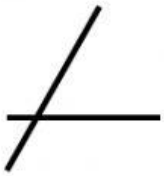		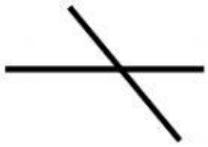
Garis Serenjang	Garis Serenjang	Garis Serenjang	Garis Serenjang	Garis Serenjang
Bukan Garis Serenjang	Bukan Garis Serenjang	Bukan Garis Serenjang	Bukan Garis Serenjang	Bukan Garis Serenjang

LIVEWORKSHEETS
LIVEWORKSHEETS