Latih Diri 8.3b

1. Salin setiap rajah yang berikut. Terangkan dan nyatakan sama ada dua sudut yang dilabel dengan a dan b ialah sudut sepadan, sudut selang-seli atau sudut pedalaman. Kemudian tandakan dengan c dan d pasangan sudut lain yang sama jenis.

(a)

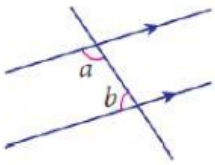

(b)

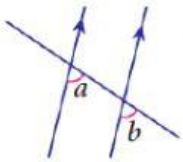

(c)

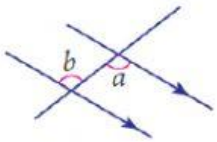

(d)

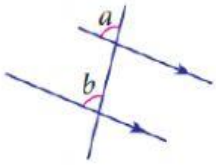

2. Salin setiap rajah yang berikut dan tandakan
   (i) sudut p jika a dan p ialah sudut sepadan.
   (ii) sudut q jika b dan q ialah sudut selang-seli.
   (iii) sudut r jika c dan r ialah sudut pedalaman.

2. (a)

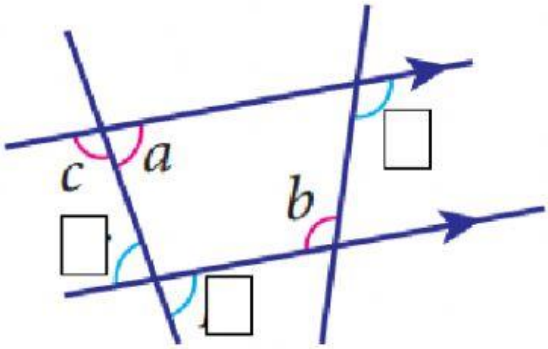

(b)

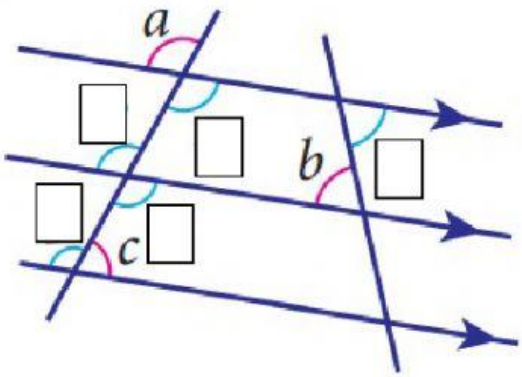

LIVEWORKSHEETS

Latih Diri 8.3c

1. Bagi setiap rajah yang berikut, tentukan sama ada garis PQ dan garis RS adalah selari atau tidak.

(a)

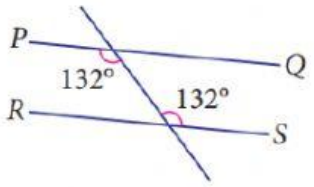

(b)

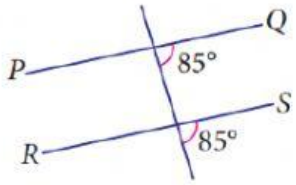

(c)

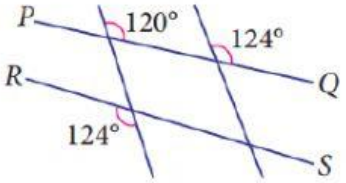

Latih Diri 8.3d

1. Dalam rajah di bawah, EF dan GH ialah garis lurus. Cari nilai a, b, c dan d.

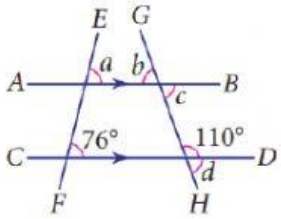

$a =$ ____ °

$b =$ ____ °

$c =$ ____ °

$d =$ ____ °

2. Dalam rajah di bawah, cari nilai a dan b.

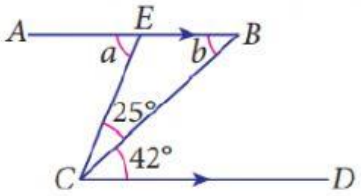

$a =$ ____ °

$b =$ ____ °

$c =$ ____ °

$d =$ ____ °

LIVEWORKSHEETS