# DECIMALES

Escribe el decimal que representa la parte pintada en cada caso



---



---



---



---

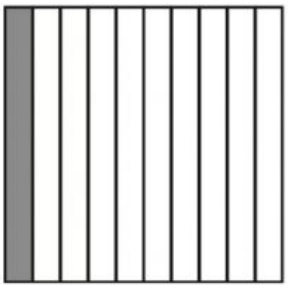

---



---

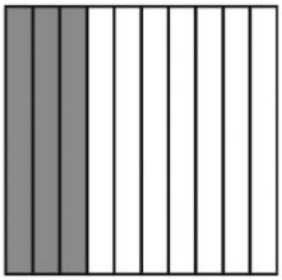

---



---



---

LIVEWORKSHEETS