Lembar kerja Peserta Didik

(LKPD)

Nama : _____ **Kelas** : **4**

Coklat utuh/keseluruhan

Tentukan bentuk pecahan biasa dan bentuk campuran dari gambar di bawah ini!

1.



Bentuk pecahan biasa	Bentuk pecahan campuran
___ / ___	___ ___ / ___

2.



Bentuk pecahan biasa	Bentuk pecahan campuran
___ / ___	___ ___ / ___

LIVEWORKSHEETS

3.



Bentuk pecahan biasa	Bentuk pecahan campuran
$\frac{\square}{\square}$	$\square\ \frac{\square}{\square}$

4.



Bentuk pecahan biasa	Bentuk pecahan campuran
$\frac{\square}{\square}$	$\square\ \frac{\square}{\square}$

LIVEWORKSHEETS