Atividade de Matemática 9° Ano

Nome: _____

Professor: José Oreste

Data: 30/08 á 03/09

1- Leia as páginas do livro 198 á 203 e responda as questões

2) Descubra a valor de x

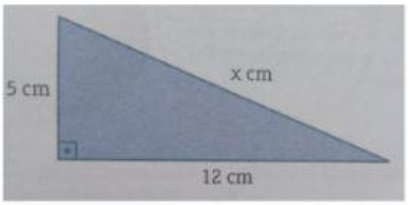

A 17

B 169

C 4.123

D 13

3) Qual valor representa a hipotenusa e quais representam os catetos, na respectiva ordem

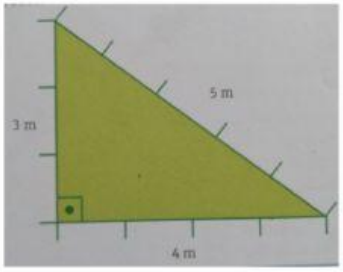

A Catetos 3 e 4 m/ Hipotenusa 5 m

B Catetos 3 e 5 m / Hipotenusa 4m

C Catetos 4 e 5 m / Hipotenusa 3 m

D N.D.A

4) O comprimento " X " que une os pontos A e B, deve ser de:

A 7 metros

B 6 metros

C 49 metros

D 35 metros

5) Determine o valor de "X" no triângulo a seguir:

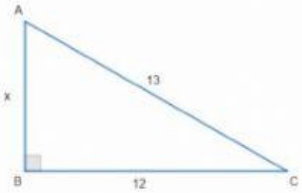

A 7

B 5

C 2

D 6

Editar com o WPS Office

LIVEWORKSHEETS

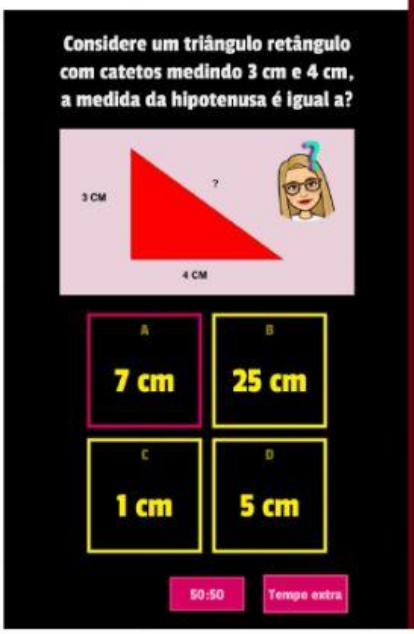

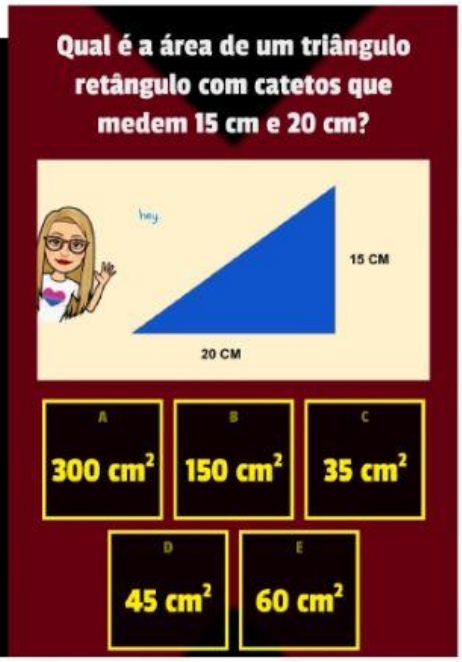

Editar com o WPS Office
LIVEWORKSHEETS