GIMNASIO BILINGÜE CAMPESTRE MARIE CURIE
Resolución de aprobación No. 647 del 28 de Noviembre de 2018 (SEC)
"Everything humankind has created originates within the mind so, develop your mind and it will make an invaluable contribution"

Math Final Exam
Third Term
First _____

Name: _____ **Date:** _____

1. What is the total value of this group of bills? Select the correct answer.

A. 5 dollars **B.** 8 dollars **C.** 4 dollars	**A.** 20 dollars **B.** 15 dollars **C.** 10 dollars

2. Read and look at the picture routines and select a.m. or p.m.

Go to school.	Go to bed.
a.m. **p.m.**	**a.m.** **p.m.**

3. The clock shows the time when **Luis goes to the library in the morning**. Represent the time and select am or pm.

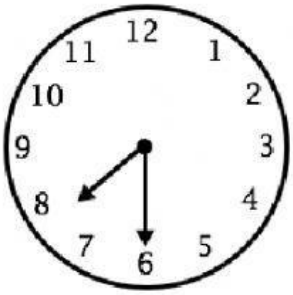

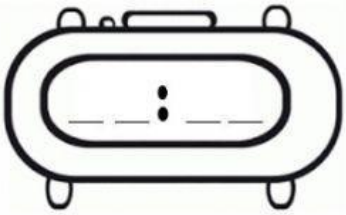

a.m.

p.m.

LIVEWORKSHEETS

4. Measure the length in centimeters

a. 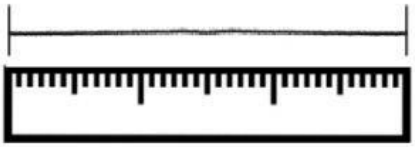

About _____ centimeters

b. 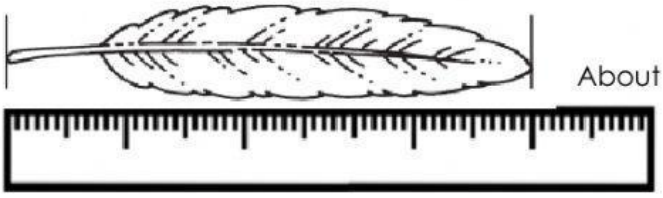

About _____ centimeters

c. 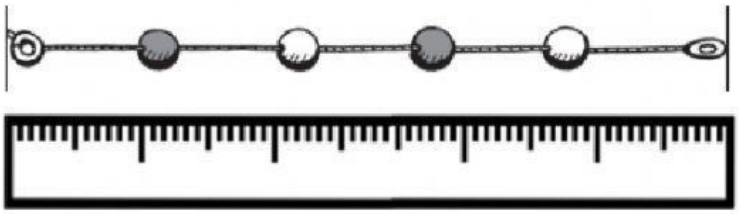

About _____ centimeters

d. 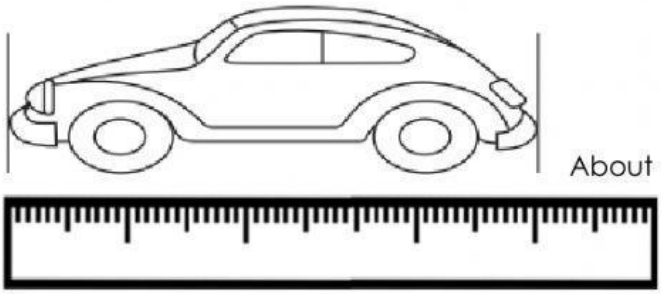

About _____ centimeters

5. Solve the word problem

- Sarah uses unit cubes to measure the length of the crayon. Circle the number in the box that makes the sentences true.

Count:

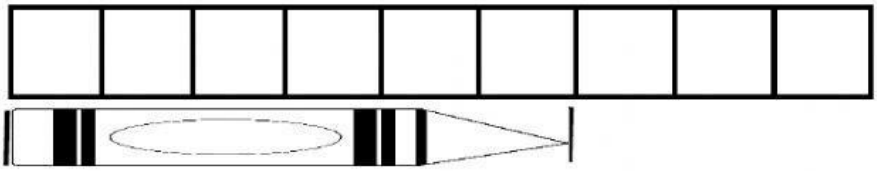

a. The crayon is 2 units long.

b. The crayon is 6 units long.

c. The crayon is 9 units long.

LIVEWORKSHEETS