EVALUACIÓN DE LA ADICIÓN EN LA RECTA NÚMERICA

U.E. "LUIS ESPINAL CAMPS 1" N.CH

REPRESENTA LA SUMA EN LA RECTA NUMÉRICA, UTILZANDO EL LAPIZ.

Observa la recta numérica en cada ejercicio y completa con la respuesta correcta.

1. 7 + 2 = ☐

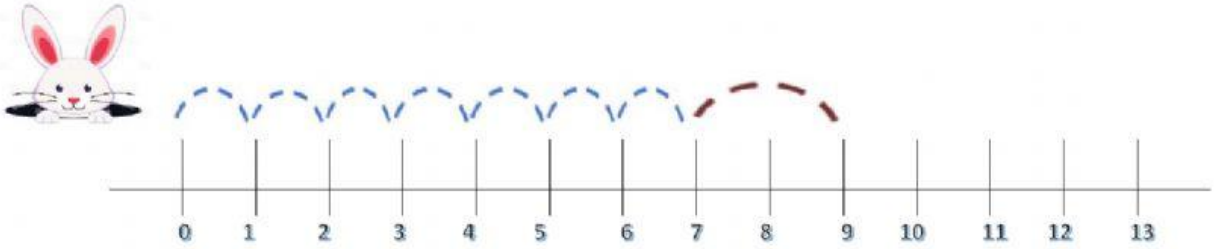

2. 4 + 3 = ☐



3. 7 + 5 = ☐

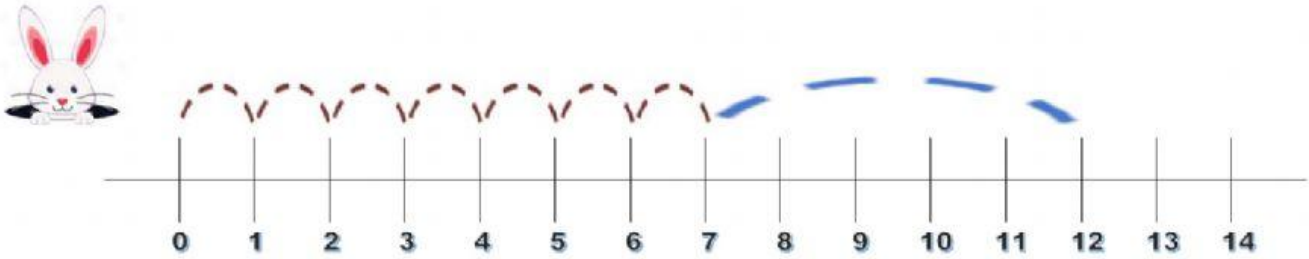

4. 10 + 4 ☐ =

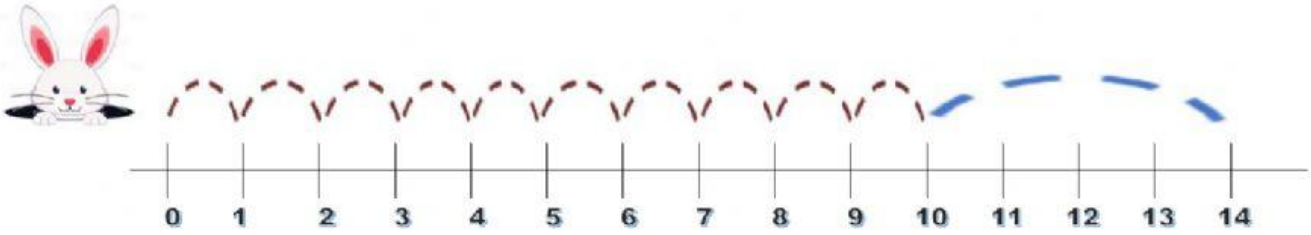

LIVEWORKSHEETS