Nyatakan isipadu cecair berikut dengan betul.

1)

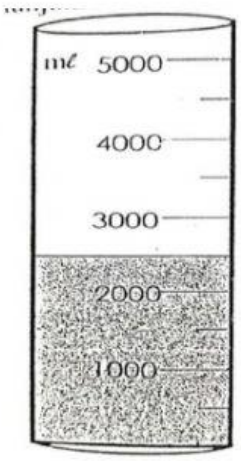

a) _____ mℓ

b) _____ ℓ

c) _____ ℓ (pecahan)

2)



a) _____ mℓ

b) _____ ℓ

3)



a) _____ mℓ

b) _____ ℓ

4)



a) _____ mℓ

b) _____ ℓ

c) _____ ℓ (pecahan)

LIVEWORKSHEETS