請寫出這些圖代表的分數數值是多少

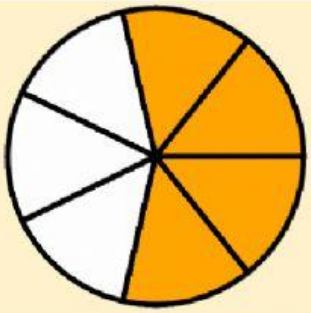

$\frac{(\quad)}{(\quad)}$

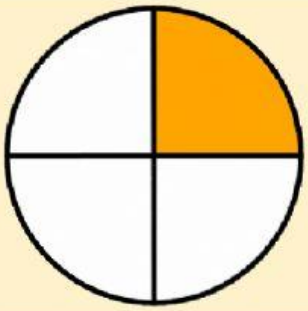

$\frac{(\quad)}{(\quad)}$



$\frac{(\quad)}{(\quad)}$

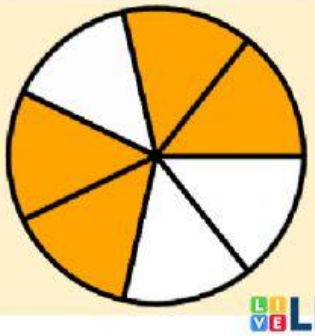

$\frac{(\quad)}{(\quad)}$

LIVEWORKSHEETS

請把圓形分數放到正確的框框中

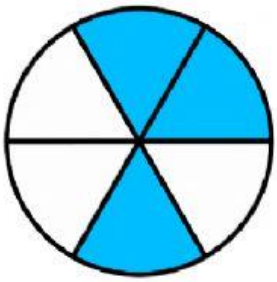

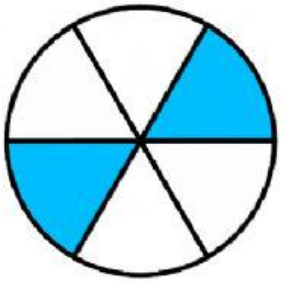

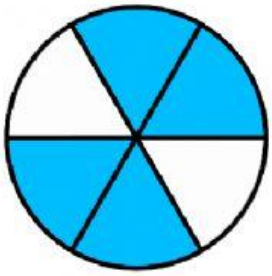

$\frac{2}{6}$	

$\frac{4}{6}$	

$\frac{3}{6}$	

LIVEWORKSHEETS

連連看，把一樣的分數連起來

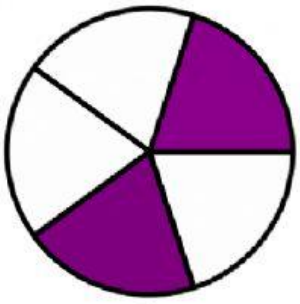

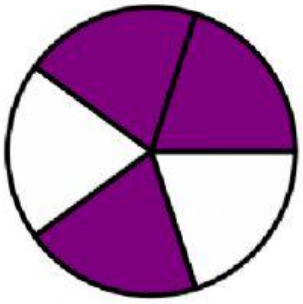

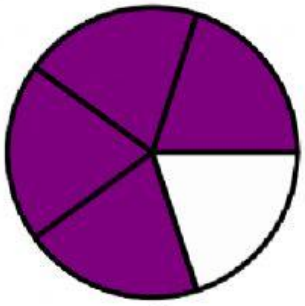

- $\frac{3}{5}$
- $\frac{4}{5}$
- $\frac{2}{5}$

LIVEWORKSHEETS

觀察這是什麼圖形，選出正確的答案吧

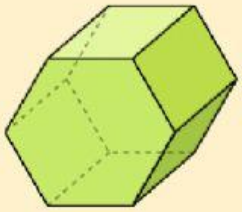

五角錐

六角錐

六角柱

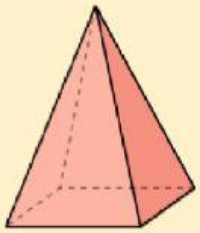

四角錐

四角柱

三角錐

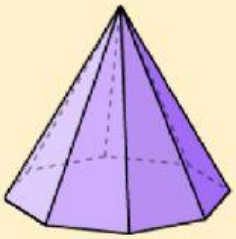

七角錐

七角柱

八角錐

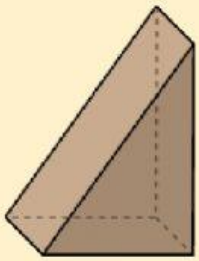

四角錐

三角錐

三角柱

LIVEWORKSHEETS