ALLTHEMOREWORKSHEETS

26 Si cada cubito mide 1 cm^3, calcula el volumen de estas figuras.

a.

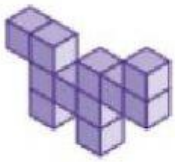

b.



c.

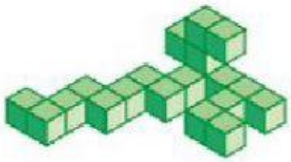

a = cm^3 **b = cm^3** **c = cm^3**

27 ¿Cuál es la unidad más adecuada para expresar el volumen en cada caso?

a = ^{3} **b = ^{3}** **c = ^{3}**

28.- Completa estas igualdades

5 dm3 =	**cm3**	**0,25 m3 =**	**dm3**
0,001 m3 =	**cm3**	**600 dm3 =**	**m3**
1.200 cm3 =	**dm3**	**55.000 cm3 =**	**m3**