∞BISMILLAAHIRRAHMAANIRRAHIIM∞

Comparing, Ordering, Estimating and Rounding Numbers

Have a go!

1 Write these numbers in order (smallest first).

14.37; 13.09; 14.4; 14.09; 13.05 → ....

2 Write <, > or = between each **pair** of decimals.

a. 0.3 ____0.03 **b.** 5.0____ 5.00

c. 0.60____0.06 **d.** 0.41 _____0.7

3 Round these to the nearest whole number.

a 45.6≈ ..... **b** 28.3 ≈ .....

c 9980.9≈ ..... **d** 512.14 ≈.....

4 Round these to the nearest tenth.

a. 7.53≈ ..... **b.** 4.55≈.....

c 104.02≈..... **d.** 900.09 ≈ .....

Maths challenge

Write the halfway number on each of these numberlines.

a

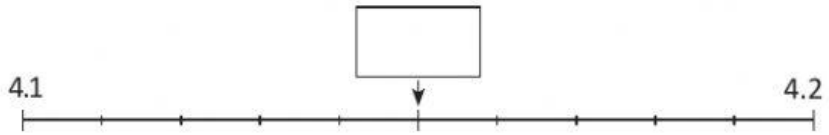

b

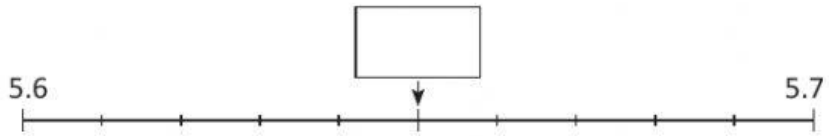

c

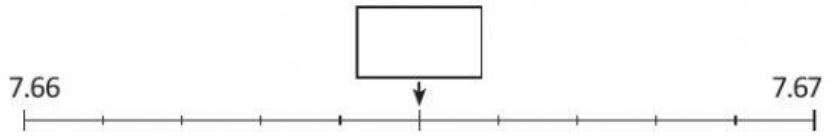

pageborders.org
LIVEWORKSHEETS

This **table** shows the 100-metre times of some of the fastest runners in the world.

Drag the name in order, starting with the fastest to the table.

Athlete	Time (seconds)
Donovan Bailey	9.84
Asafa Powell	9.72
Tyson Gay	9.69
Usain Bolt	9.58
Maurice Green	9.79
Leroy Burrell	9.85

Athlete	Time (seconds)
1	
2	
3	
4	
5	
6	

Select all the numbers that is 5 if it is rounded to the nearest whole number.

4.34	4.09	5.91	5.2	5.18
4.87	5.67	4.75	6.09	5.35

∞ALHAMDULILLAAHIROBBIL'AALAMIIN∞

pageborders.org

LIVEWORKSHEETS