Subjek: Matematik

Topik : Perimeter (Segi Tiga Sama Kaki)

Nama: _____ Kelas: _____

Arahan: Carikan panjang lilitan/ perimeter bagi segi tiga sama kaki yang berikut:

Contoh:

Cari panjang lilitan / perimeter segi tiga sama sisi yang berikut:

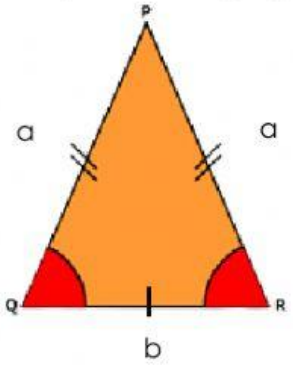

a = 6 ; b = 5

Jawapan: a + a + b

= 6 + 6 + 5

= 2(**6**) + 5

= 12 + 5

= **17** cm

1. Cari panjang lilitan / perimeter segi tiga sama kaki yang berikut:

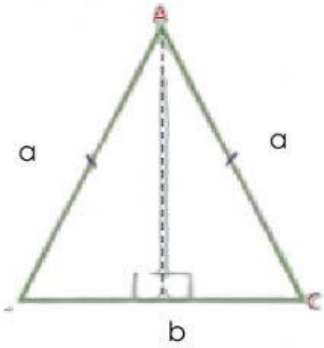

a = 7 ; b = 4

Jawapan: 7 + 7 + 4

= 2 x 7 + 4

= 14 + 4

= ☐ cm

2. Cari panjang lilitan / perimeter segi tiga sama kaki yang berikut:

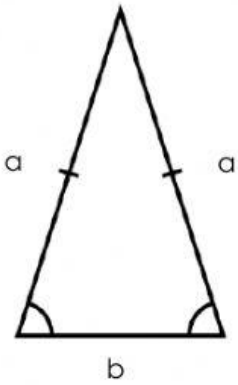

a = 5 ; b = 3

Jawapan: 5 + 5 + 3

= 2 (**5**) + 3

= 10 + 3

☐ cm

LIVEWORKSHEETS

Sambungan…

3. Cari panjang lilitan / perimeter segi tiga sama kaki yang berikut:

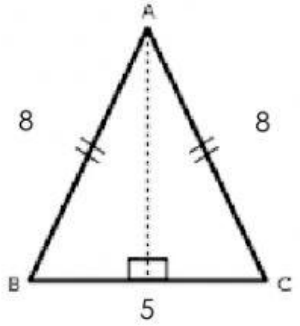

Jawapan: 8 + 8 + 5
= 2(8) +5
= ☐ + 5
= ☐ cm

4. Cari panjang lilitan / perimeter segi tiga sama kaki yang berikut:

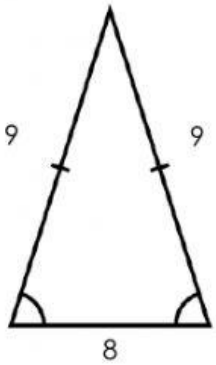

Jawapan: 9 + 9 + 8
= 2(9) + 8
=(☐) +8
= ☐ cm

5. Cari panjang lilitan / perimeter segi tiga sama kaki yang berikut:

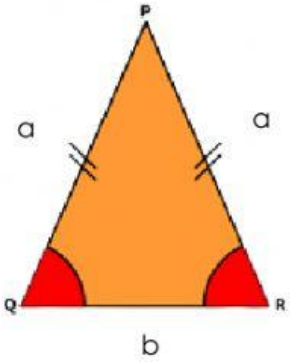

a = 10 ; b = 5

Jawapan: a + a + b
= ☐ + ☐ + ☐
= 2 ☐ + ☐
= ☐ + ☐
= ☐ cm

LIVEWORKSHEETS