Lengkapkan konsep darab dibawah.

Contoh:

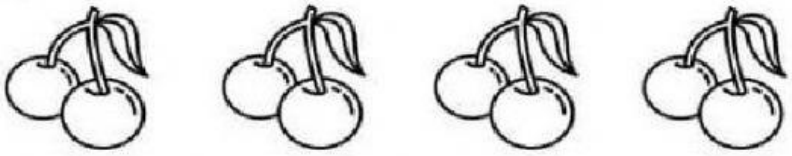

Ada **4** kumpulan dua-dua

1)



Ada ____ kumpulan ____

2)

Ada ____ kumpulan ____

3)



Ada ____ kumpulan ____

LIVEWORKSHEETS

4)

Ada ☐ kumpulan ☐

5)



Ada ☐ kumpulan ☐

6)



Ada ☐ kumpulan ☐

7)



Ada ☐ kumpulan ☐

LIVEWORKSHEETS