A CONTAR ¿CUÁNTOS TRIÁNGULOS HAY?

Observa cada figura y cuenta cuantos triángulos hay como máximo.

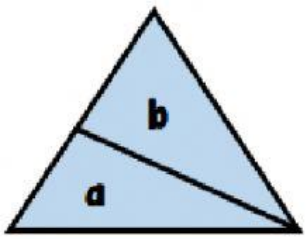

1 letra		
2 letras		
	TOTAL	

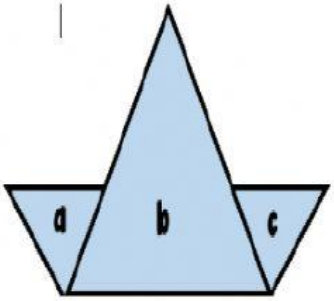

1 letra		
2 letras		
3 letras		
	TOTAL	

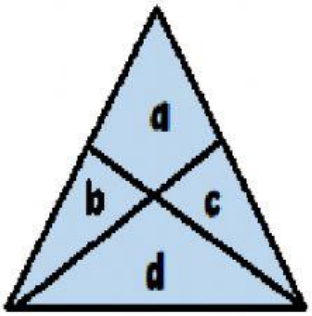

1 letra		
2 letras		
3 letras		
4 letras		
	TOTAL	

LIVEWORKSHEETS

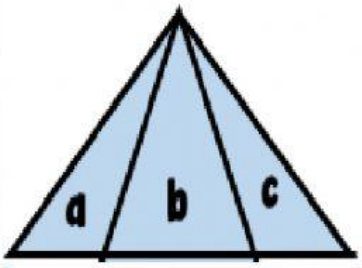

1 letra		
2 letras		
3 letras		
	TOTAL	

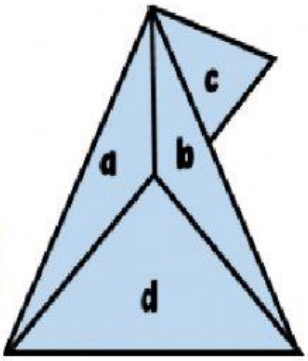

1 letra		
2 letras		
3 letras		
4 letras		
	TOTAL	

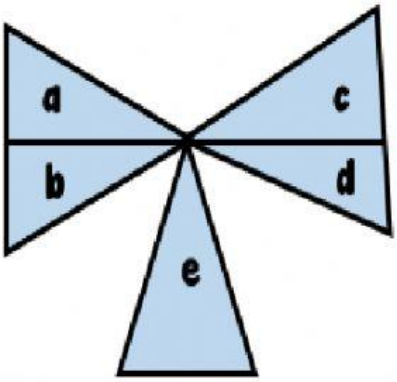

1 letra		
2 letras		
3 letras		
4 letras		
5 letras		
	TOTAL	

LIVEWORKSHEETS