DETERMINACIÓN DEL VALOR CON BLOQUES

RECUERDA:



1 CENTENA (100)

1 DECENA (10)

1 UNIDAD

OBSERVA LOS BLOQUES Y COMPLETA LOS DATOS:

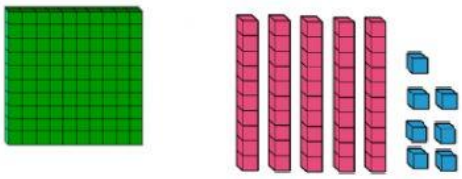

C	D	U
1	5	7

C	D	U
100	50	7

157

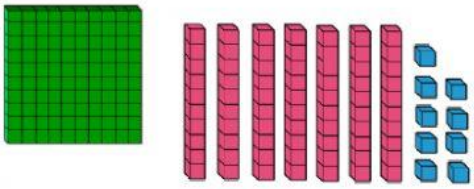

C	D	U

C	D	U

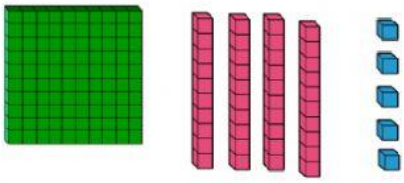

C	D	U

C	D	U

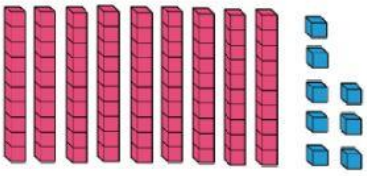

C	D	U

C	D	U



C	D	U

C	D	U

LIVEWORKSHEETS

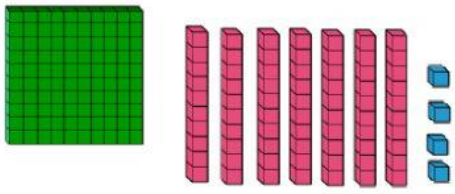

C	D	U

C	D	U

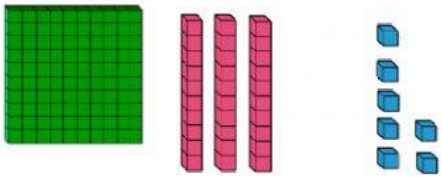

C	D	U

C	D	U

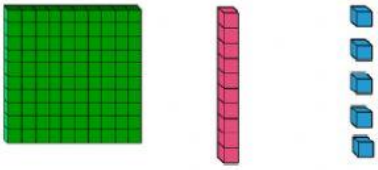

C	D	U

C	D	U

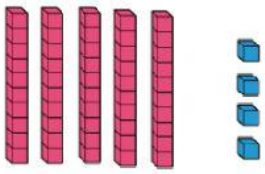

C	D	U

C	D	U

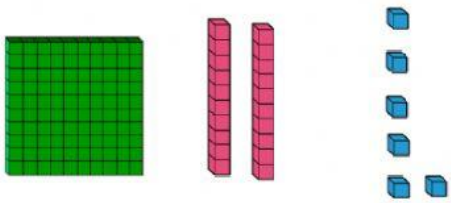

C	D	U

C	D	U

C	D	U

C	D	U

LIVEWORKSHEETS

LEE LAS SIGUIENTES DESCOMPOSICIONES DE NÚMEROS Y ÚNELAS CON LA CIFRA QUE FORMA:

100	+ 50	+ 3		147
100	+ 80	+ 1		195
100	+ 40	+ 7		176
100	+ 60	+ 4		153
100	+ 10	+ 2		129
100	+ 90	+ 5		112
100	+ 20	+ 9		181
100	+ 70	+ 6		138
100	+ 30	+ 8		164

LEE Y COMPLETA LOS CUADROS:

	C	D	U
a. Ciento cuarenta y tres.	1	4	3
b. Ciento setenta y cuatro			
c. Ciento sesenta y seis			
d. Ciento noventa			
e. Ciento diecisiete			

D'JYM

LIVEWORKSHEETS