Nama :

Padankan gambarajah segi tiga dengan jawapan yang betul.

Luas segi tiga bersudut tegak = $\frac{1}{2}$ x tapak x tinggi

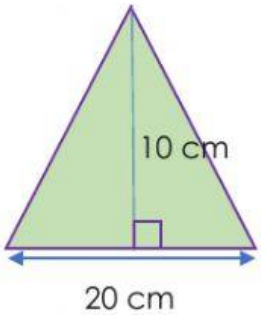

Luas segi tiga = ½ x tapak x tinggi

= ½ x 13 cm x 10 cm

= $\frac{13 \text{ cm} \times 10 \text{ cm}}{2}$

= 65 cm²

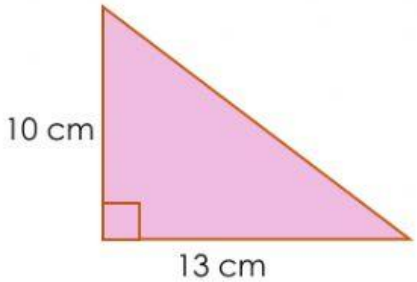

Luas segi tiga = ½ x tapak x tinggi

= ½ x 15 cm x 12 cm

= $\frac{15 \text{ cm} \times 12 \text{ cm}}{2}$

= 90 cm²

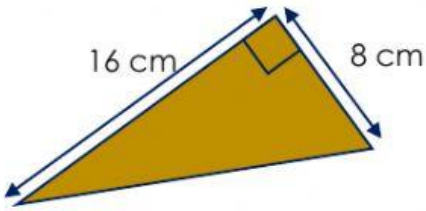

Luas segi tiga = ½ x tapak x tinggi

= ½ x 23 cm x 12 cm

= $\frac{23 \text{ cm} \times 12 \text{ cm}}{2}$

= 138 cm²

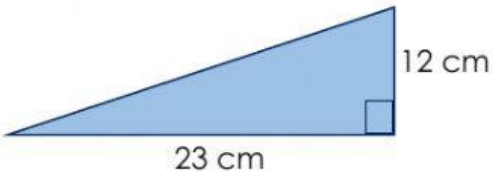

Luas segi tiga = ½ x tapak x tinggi

= ½ x 20 cm x 10 cm

= $\frac{20 \text{ cm} \times 10 \text{ cm}}{2}$

= 100 cm²

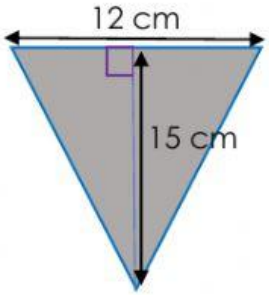

Luas segi tiga = ½ x tapak x tinggi

= ½ x 8 cm x 16 cm

= $\frac{8 \text{ cm} \times 16 \text{ cm}}{2}$

= 64 cm²

LIVEWORKSHEETS