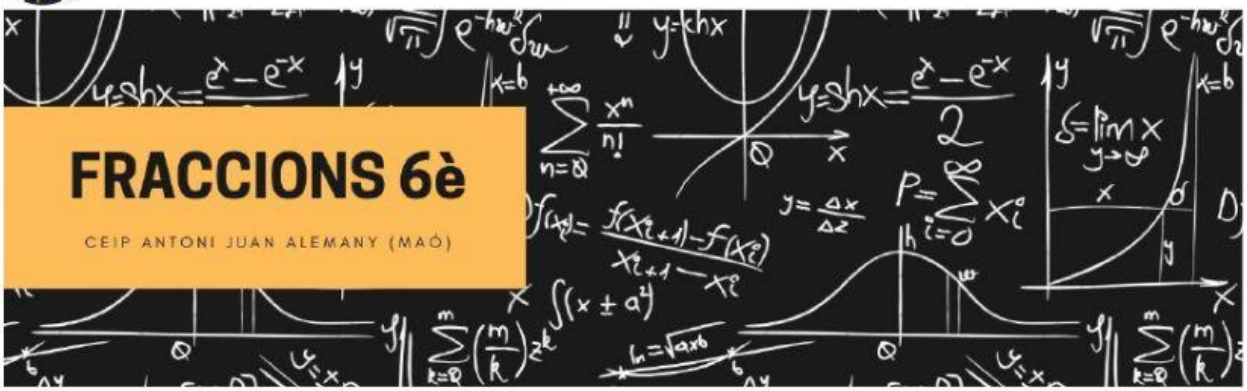

FRACCIONS I NOMBRES MIXTS

1. Completa en forma de FRACCIÓ IMPRÒPIA i en forma de NOMBRE MIXT:

Dibuix	Fracció impròpia	Nombre mixt
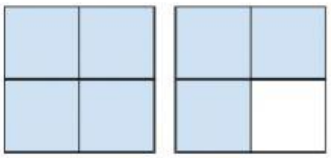	_____	+ _____
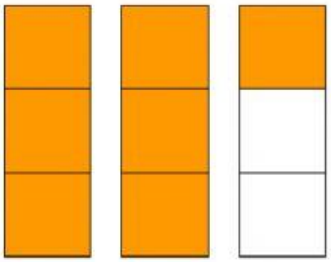	_____	+ _____
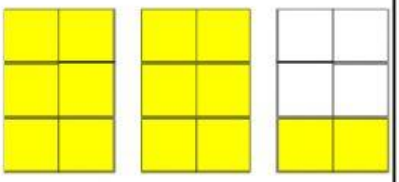	_____	+ _____

LIVEWORKSHEETS

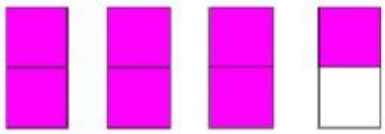	____	+ ____

2. Expressa aquestes fraccions com a nombres mixts. Fes el dibuix a la llibreta si t'ajuda:

a) $\frac{15}{4}$ = ____ + ____

b) $\frac{12}{5}$ = ____ + ____

c) $\frac{32}{7}$ = ____ + ____

d) $\frac{31}{12}$ = ____ + ____

3. Expressa cada lletra en forma de nombre mixt:

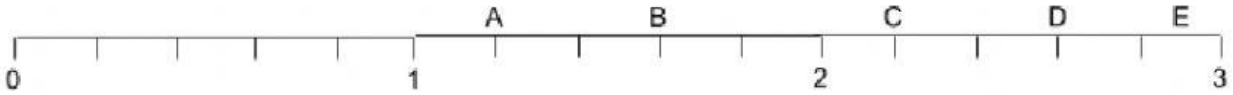

A= + ____ B= + ____ C= + ____

D= + ____ E= + ____

LIVEWORKSHEETS