NAME _____ **SEC**_____ **DATE**_____

1. Compare the following animals in terms of height and fill in the blanks.

hippopotamus

mouse



leopard

a) The _____ is the tallest animal here.

b) The _____ is the shortest animal here.

c) Leopard is _____ than the mouse. (taller/ shorter)

d) Mouse is _____ than the leopard. (taller/ shorter)

2. Which of the following is longest? (Choose one box)

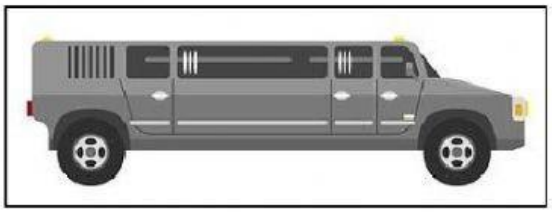



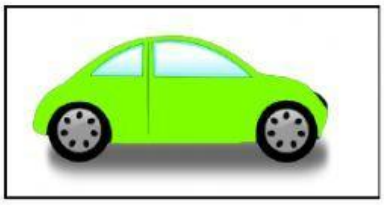

LIVEWORKSHEETS

3. Choose the animal that has shorter neck.

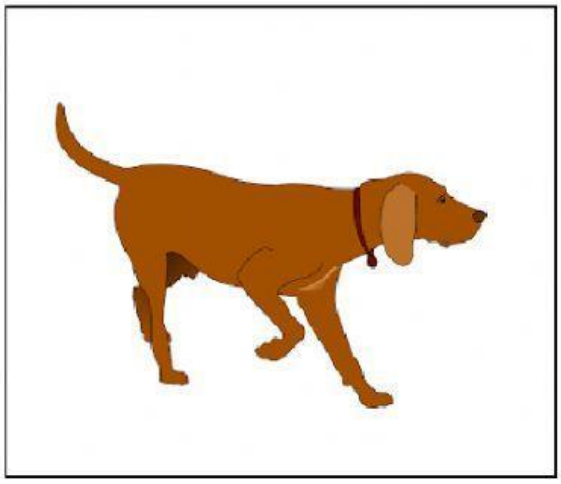



4. Which of the following is tallest? (Choose one box)

LIVEWORKSHEETS